Nama: Kelas:

PENJUMLAHAN DENGAN KODE

Tulis hasil penjumlahan lingkaran berwarna seesuai dengan kode angka berikut ini!

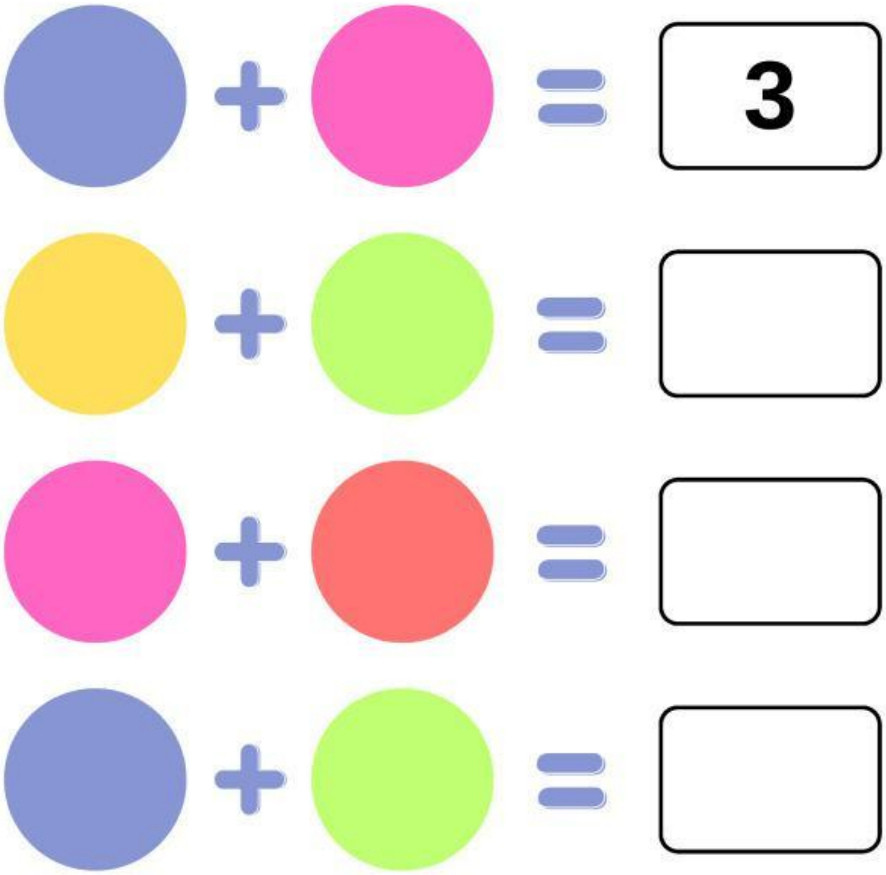

LIVEWORKSHEETS

MARI BERHITUNG

Hitunglah hasil penjumlahan dan pengurangan di bawah ini sesuai dengan gambar

+

= 5

−

= ☐

+

= ☐

−

= ☐

LIVEWORKSHEETS

Berhitung 1 Sampai 10

Ayo hitung dan pasangkan dengan bilangan yang tepat!

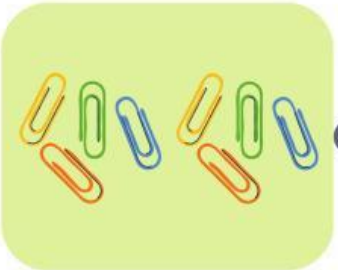

1

3

4

5

6

7

8

9

10

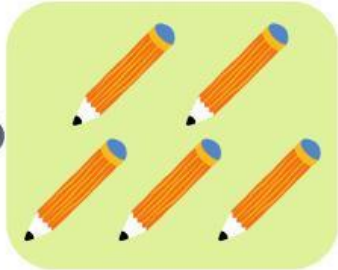

LIVEWORKSHEETS

Berhitung & Hubungkan Gambar

Hitung berapa banyak sayuran yang ada dan cocokkan dengan jumlah yang benar!



8



7



6



5

LIVEWORKSHEETS

Angka Warna

Berilah angka pada lingkaran sesuai dengan kode warnanya.

Contoh:



LIVEWORKSHEETS