MENGUKUR VOLUME DENGAN SATUAN TIDAK BAKU

NAMA : KELAS :

PETUNJUK : Hitunglah volume bangun di bawah ini dengan benar!

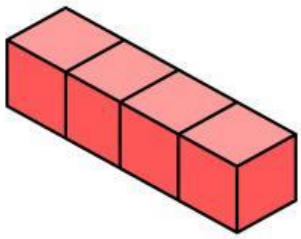

Berapakah kubus satuannya?

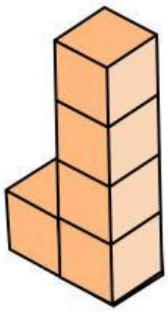

Berapakah kubus satuannya?



Berapakah kubus satuannya?



Berapakah kubus satuannya?

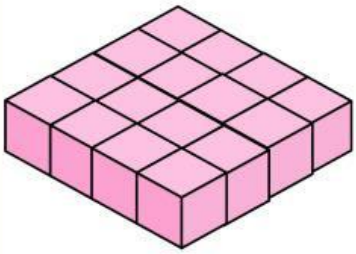

Berapakah kubus satuannya?

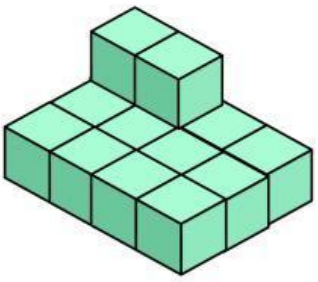

Berapakah kubus satuannya?

LIVEWORKSHEETS