Kesan perubahan nilai *a*, *b* dan *c* ke atas graf kuadratik

Diberi $f(x) = ax^2 + bx + c$ dengan keadaan a, b dan c ialah integer. Isikan ruang jawapan dengan fungsi kuadratik yang betul.

$f(x) = ax^2 - bx + c$

$f(x) = ax^2 - bx - c$

$f(x) = -ax^2 + bx + c$

$f(x) = -ax^2 - bx + c$

$f(x) = -ax^2 + c$

$f(x) = -ax^2 - bx - c$

$f(x) = -ax^2 - c$

$f(x) = ax^2$

$f(x) = ax^2 + bx - c$

$f(x) = ax^2 - bx + c$

1)

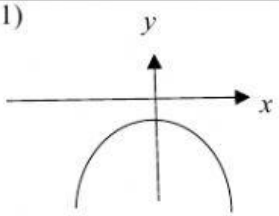

2)

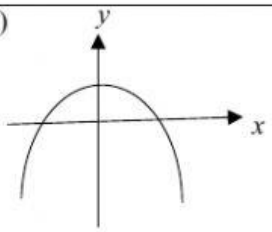

3)

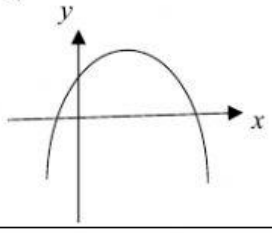

4)

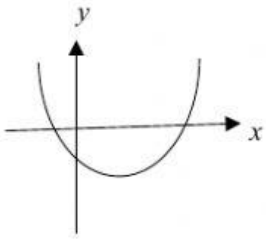

5)

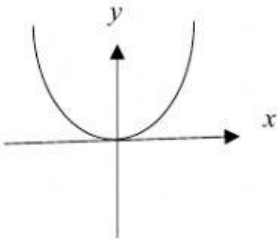

6)

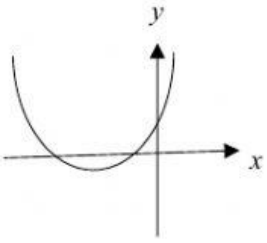

7)

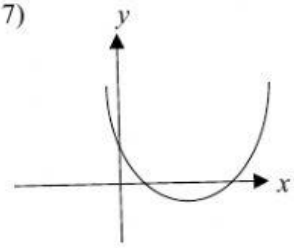

8)

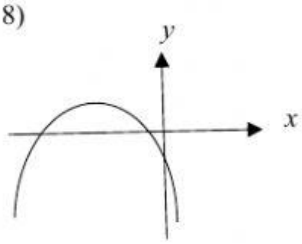

9)

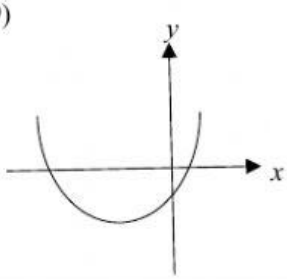

10)

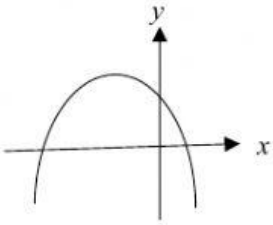

LIVEWORKSHEETS