LET'S ANSWER – ELECTRICAL TERMS

1:00

W 1 – L2- Electrical circuit

Match the description with the correct symbol. Name: Class:

Pictorial diagram 1- -------	schematic diagram 2- -------	Direct current 3- --------	Alternating current 4- ---------	Conventional current 5- ---------	Electron current 6- --------
	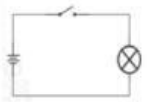	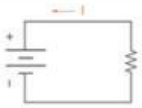	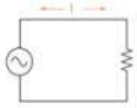	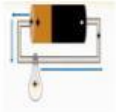	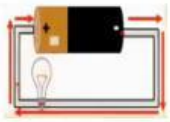

A	B	C	D	E	F
flows from the positive to the negative terminal of the source	AC: changes its direction, going back and forth around a circuit	travel from the - terminal to the + terminal of the battery/source.	Using realistic pictures to represent the components of an electrical circuit	DC : go the same way around a circuit	Using graphic symbols to represent the components of an electrical circuit

Share a screenshot of your work