INTERSECCIÓN DE CONJUNTOS

Nombre: ……..... 5to grado. A - B
Primer Trimestre

1. Expresa por extensión la intersección:

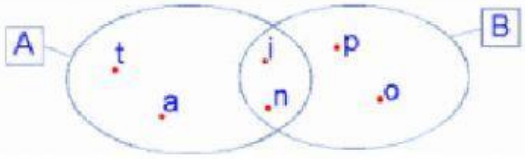

A = {t, i, n, a}
B = {p, i, n, o}
A ∩ B = {____, ____}

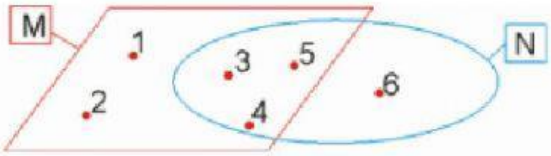

J = {_____, _____, _____}
R = {_____, _____, _____, _____}
J ∩ R = {_____, ____}

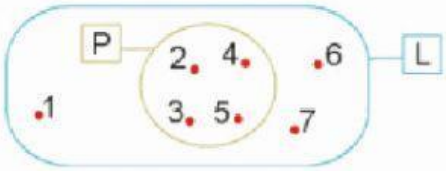

P = {____ ; ____ ; ____ ; ____}
L = {____ ; ____ ; ____ ; ____ ; ____ ; ____ ; ____}
P ∩ L = {____ ; ____ ; ____ ; ____}

2. Completa:

3 Dado el diagrama:

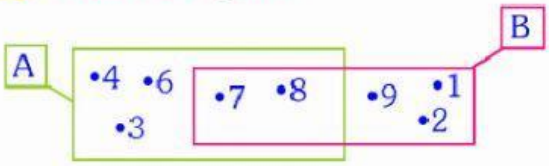

Completar:

A = {.....}

B = {.....}

A ∩ B = {.....}

5 Observa en el siguiente diagrama los conjuntos A, B y C.

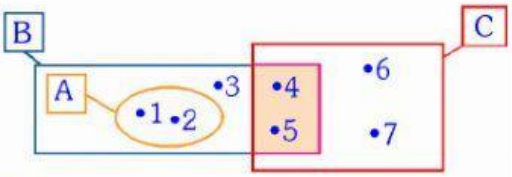

Escribe por extensión:

A ∩ B = {.....}

B ∩ C = {.....}

A ∩ C = {.....}

https://matematicaj.blogspot.com/2018/12/operaciones-con-conjuntos-ejercicios.html
https://algebraenpdf.blogspot.com/2019/09/interseccion-de-conjuntos-problemas-resueltos-pdf.html

LIVEWORKSHEETS