Name: Click or tap here to enter text.

Calculating Area Worksheet

Directions: Calculate the area of each rectangle then type your answer in each box.
Remember, Area = L (length) X W (width)

1) Area = ____ sq. units



2) Area = ____ sq. units

3) Area = ____ sq. units



4) Area = ____ sq. units

LIVEWORKSHEETS



5) Area = _____ sq. units

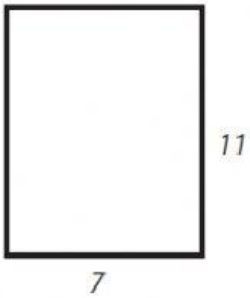

6) Area = _____ sq. units

LIVEWORKSHEETS