Escola: _____

Nome: _____

Data: _____, ____ de _____ de _____.

Turma: _____ Professor(a): _____

Escreva a

FRAÇÃO

que corresponde à região colorida.

a. _____



b. _____

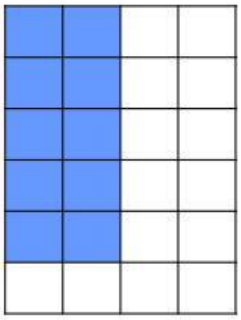

c. _____

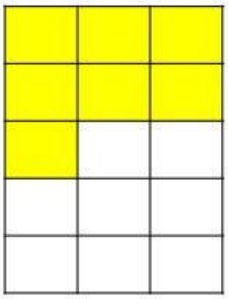

d. _____

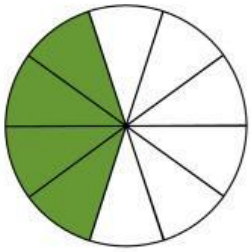

e. _____

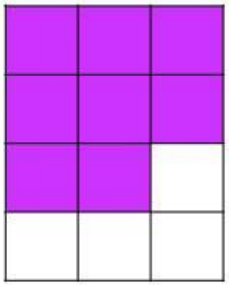

f. _____

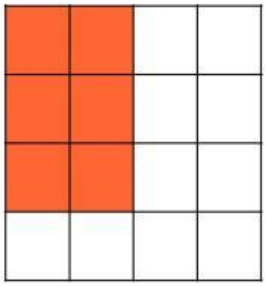

g. _____



h. _____

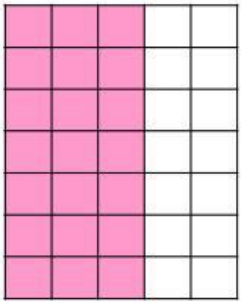

i. _____

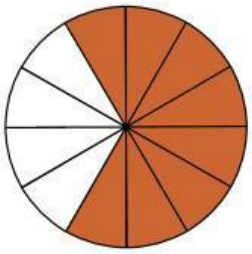

j. _____

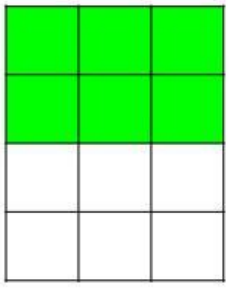

k. _____

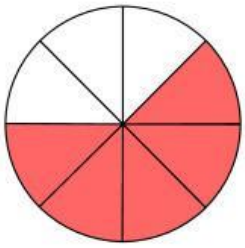

l. _____

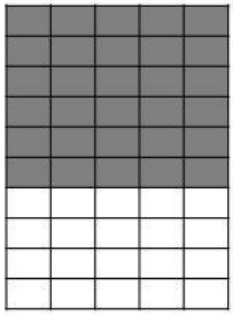

LIVEWORKSHEETS

Escola: _____

Nome: _____

Data: _____, ___ de _____ de _____.

Turma: _____ Professor(a): _____

Observe o exemplo e complete a tabela de acordo com as imagens das

FRAÇÕES

	Fração	Numerador	Denominador	Leitura
a. 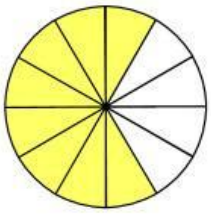	$\frac{8}{12}$	8	12	Oito doze avos
b. 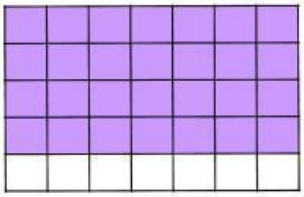				
c. 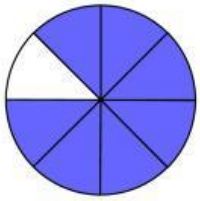				
d. 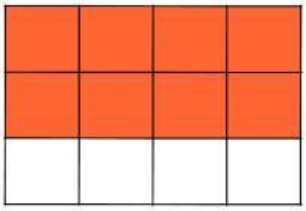				
e. 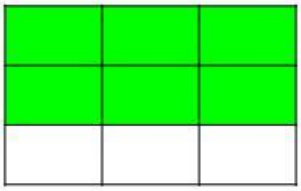				
f. 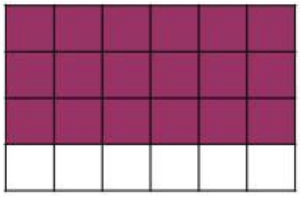				

LIVEWORKSHEETS