זוויות צמודות

1.באיזה סרטוט? α ו β -הן זוויות צמודות. נא לסמן V ליד זוויות צמודות.

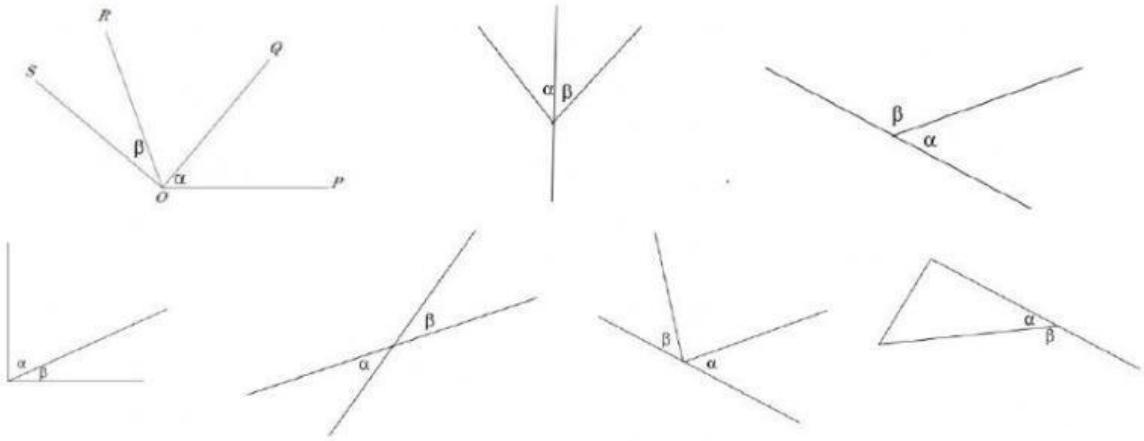

2. מצאו את α בתרגילים הבאים .

א.

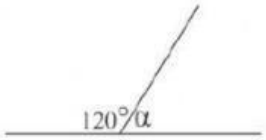

α =

ב.

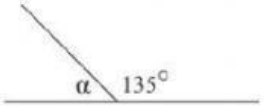

α =

ג.

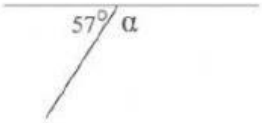

α =

ד.

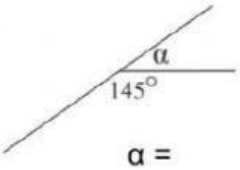

α =

ה.

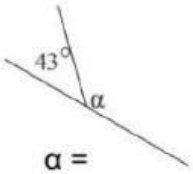

α =

ו.

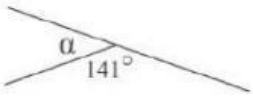

α =

3. בכל אחד מהמשולשים הבאים המשיכו את הצלעות משני הצדדים. מצאו את α ו- β

א.

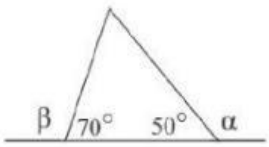

β = α =

ב.

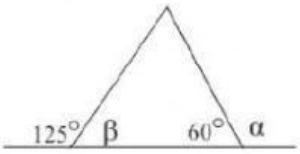

β = α =

ג.

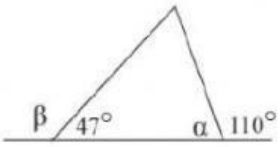

β = α =

4. בכל אחד מהסרטוטים הבאים יש שתי זוויות צמודות. מצאו את x.

א.

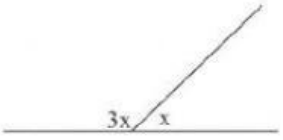

x =

ב.

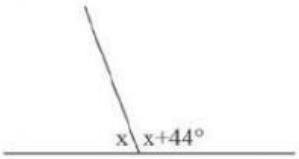

x =

ג.

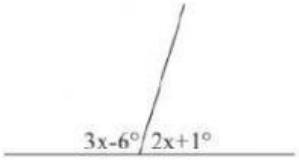

x =

LIVEWORKSHEETS