Өртөө- 2

1. Тэгш өнцөгт гурвалжны мэдэгдэхгүй байгаа талын уртыг ол.

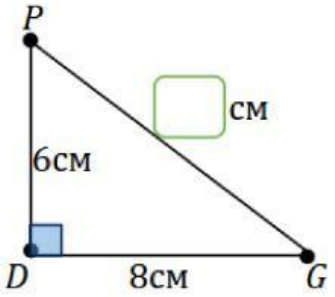

$PG^2 = PD^2 + DG^2$

$PG^2 =$ +

$PG =$

2. Диагоналийн уртыг ол.

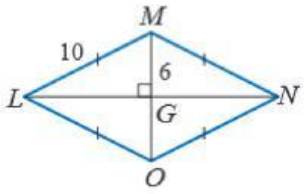

$10^2 = LG^2$ +

$LM =$

LN

3. Шатны уртыг олоорой.

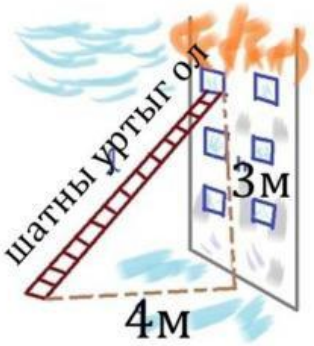

шатны урт:

LIVEWORKSHEETS