Nama : ..... Kelas : .....

SIMBOL ELEKTRONIKA

Hubungkan simbol elektronika berikut sesuai dengan namanya dengan benar!

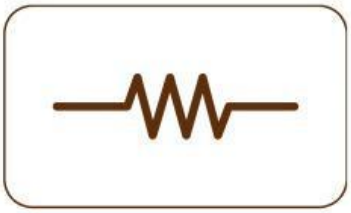

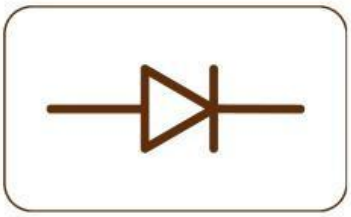

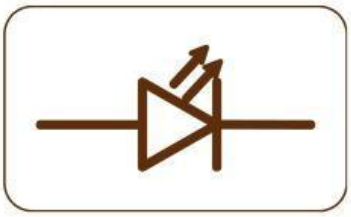

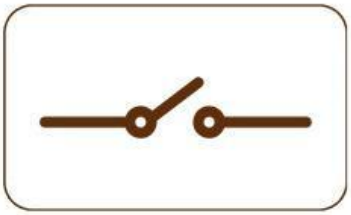

Hambatan

LED

Relai

Dioda

Saklar

Kapasitor

LIVEWORKSHEETS