Reformed Pearson Edexcel Functional Skills Entry 1

Section B – Calculator

Mathematics

Practice Paper
For first teaching September 2019
Time: 60 minutes

Candidate name	
Candidate signature	Date

You must have a

- black or blue ink pen
- pencil
- ruler
- rubber
- calculator.

Instructions

- Answer every question.
- You can write or draw to show your answers.
- You may use a calculator.

Information

- The total number of marks for this section is 15.

Advice

- Read each question carefully.
- Check your work at the end.
- Ask if you do not understand any words.

Turn over ▶

W64155A
©2019 Pearson Education Ltd.
1/1/1/1/1

W 6 4 1 5 5 A

Pearson

LIVEWORKSHEETS

1 Rita works in a sports centre.

A customer needs to pay £15 for a ticket.

The customer gives Rita this note.



He gives Rita one more note.

Which note does the customer give Rita?

Use the correct symbol for money. (2)

Show your answer here.

LIVEWORKSHEETS

2 This is a swimming pool ticket.

This is a gym ticket.

Rita has tickets in a box.

Which are the swimming pool tickets in the box? **(1)**

Tick (✔) all the correct tickets.

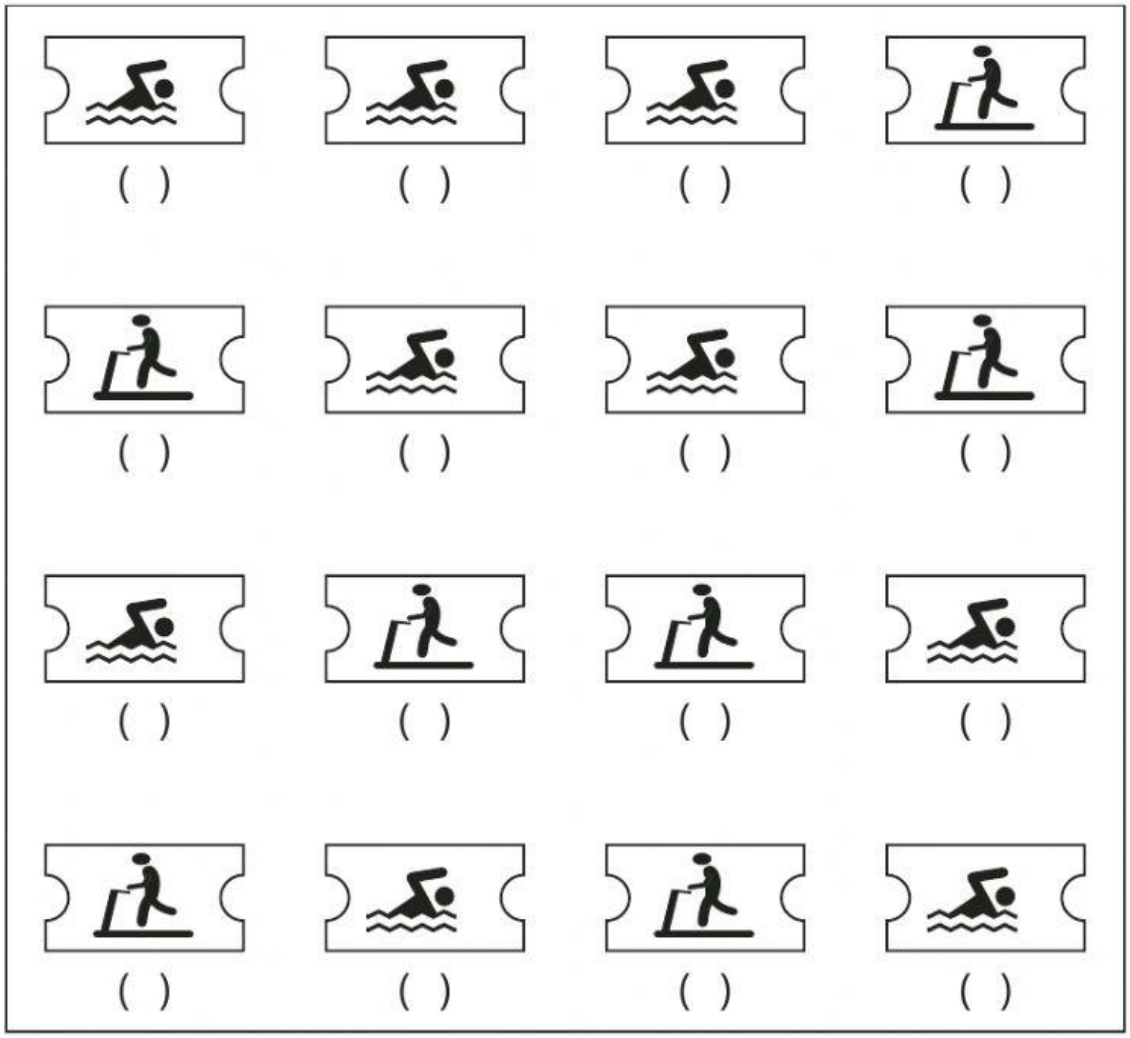

LIVEWORKSHEETS

3 This is how Rita works out the change for a customer.

$$20 - 15 = 5$$

Rita can check her answer in a different way.

Show how Rita can check her answer. **(1)**

Show your check here.

LIVEWORKSHEETS

4 Rita has these table tennis bats.



Rita gives 14 bats to people in a table tennis class.

How many bats does Rita have left over? **(1)**

Show your answer here.

LIVEWORKSHEETS

5 Rita gives a prize for table tennis.

The prize is for the player who wins the most games.

Who gets the prize? **(1)**

Tick (✔) the correct answer.

Barry wins 8 games	Eve wins 17 games
( )	( )
Olga wins 13 games	Salim wins 9 games
( )	( )

LIVEWORKSHEETS

6 Rita has a list of classes at the sports centre.

cycling	12 people
dance	17 people
football	16 people
swimming	12 people
tennis	11 people
yoga	19 people

A customer chooses the class with the fewest people.

Which class does the customer choose? **(1)**

Show your answer here.

LIVEWORKSHEETS

7 Rita has posters of classes in different seasons.

Rita uses the posters in the order of the seasons.

She uses the first poster in the spring.

Which poster will Rita use next? **(1)**

Tick (✔) the correct poster.

spring	winter
( )	( )

autumn	summer
( )	( )

LIVEWORKSHEETS

8 The clock shows the time a yoga class starts.

10 : 00

Rita says the yoga class starts at one o'clock.

Is Rita correct?

Show why you think this. **(2)**

Show your answer here.

Tick (✔) the correct answer.

Yes ( ) No ( )

LIVEWORKSHEETS