Lembar Kerja Peserta didik

# LKPD

## MATEMATIKA

### Penjumlahan Dan Pengurangan

5+3=8

Nama : .....

Kelas : .....

LIVEWORKSHEETS

# A.Cara melakukan penjumlahan

Maya Memetik 14 buah jambu air
Zahra memetik 5 buah lebih banyak
lebih dari jambu air milik Maya
Berapa banyak jambu air yang dipetik oleh kira?

**Cara 1: Menghitung maju**

| | | | | | | | | | |
|---|---|---|---|---|---|---|---|---|---|
| 11 | 12 | 13 | 14 | 15 | 16 | 17 | 18 | 19 | 20 |

12

13,14,15,16,17,18

12+6=18

# B.Cara Melakukan Pengurangan

Minara mempunyai 12 buah anggur
Nabila mempunyai 18 buah anggur
Berapa selisih banyak banyak anggur minara dan nabila?

$$\begin{array}{r} \cancel{1}8 \\ \cancel{1}2 \; - \\ \hline 06 \end{array}$$

LIVEWORKSHEETS

Nama : Kelas :

# Pengurangan Di Bawah 30

Hitunglah operasi pengurangn di bawah ini dan hubungkanlah dengan jawaban yang tepat!

| | |
|---|---|
| 6 - 2 = | 8 |
| 5 - 2 = | 2 |
| 20 - 12 = | 4 |
| 8 - 6 = | 28 |
| 12 - 12 = | 3 |
| 19 - 3 = | 7 |
| 8 - 1 = | 0 |
| 29 - 1 = | 16 |

LIVEWORKSHEETS

Nama : .....

Kelas : .....

# Titik Dadu yang Hilang

Selesaikan penjumlahan dibawah dengan menuliskan angka yang tepat di dadu yang hilang.










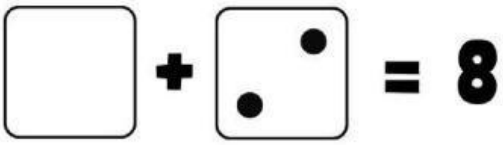





















LIVEWORKSHEETS

# MENGHITUNG SAYUR

*Tuliskan angka sesuai hasil penjumlahan dan pengurangan berikut*



4

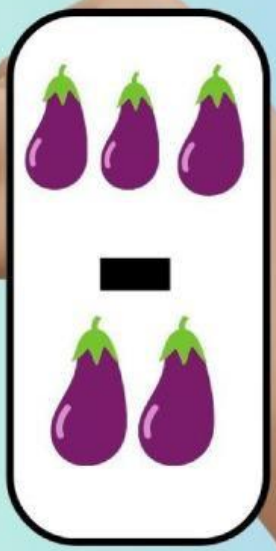

....



....



....



....



....

LIVEWORKSHEETS