Lembar Kerja Peserta didik

LKPD

MATEMATIKA

Penjumlahan Dan Pengurangan

5+3=8

Nama : .....

Kelas : .....

LIVEWORKSHEETS

A.Cara melakukan penjumlahan

Maya Memetik 14 buah jambu air
Zahra memetik 5 buah lebih banyak
lebih dari jambu air milik Maya
Berapa banyak jambu air yang dipetik oleh kira?

Cara 1: Menghitung maju

11	12	13	14	15	16	17	18	19	20

12

13,14,15,16,17,18

12+6=18

B.Cara Melakukan Pengurangan

Minara mempunyai 12 buah anggur
Nabila mempunyai 18 buah anggur
Berapa selisih banyak banyak anggur minara dan nabila?

$$\begin{array}{r} \cancel{1}8 \\ \cancel{1}2 \; - \\ \hline 06 \end{array}$$

LIVEWORKSHEETS

Nama : Kelas :

Pengurangan Di Bawah 30

Hitunglah operasi pengurangn di bawah ini dan hubungkanlah dengan jawaban yang tepat!

6 - 2 =	8
5 - 2 =	2
20 - 12 =	4
8 - 6 =	28
12 - 12 =	3
19 - 3 =	7
8 - 1 =	0
29 - 1 =	16

LIVEWORKSHEETS

Nama : .....

Kelas : .....

Titik Dadu yang Hilang

Selesaikan penjumlahan dibawah dengan menuliskan angka yang tepat di dadu yang hilang.







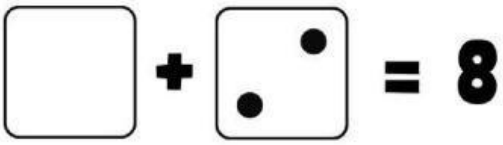















LIVEWORKSHEETS

MENGHITUNG SAYUR

Tuliskan angka sesuai hasil penjumlahan dan pengurangan berikut



4

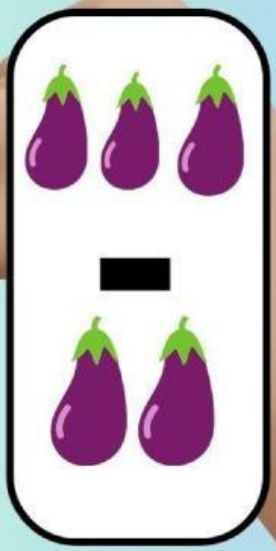

....



....



....



....



....

LIVEWORKSHEETS