Lembar Kerja Peserta Didik

LKPD

Bangun Datar



LIVEWORKSHEETS

MENGENAL BANGUN DATAR

BERIKAN TANDA

SEGITIGA

LINGKARAN

KERUCUT

KUBUS

PERSEGI

TRAPESIUM

LONJONG

SEGITIGA

LIVEWORKSHEETS





SOAL

TOLONG ISI TITIK UNTUK MENJAWAB SOAL INI, CONTOH BANGUN DATAR PADA BANGUN DIATAS

LIVEWORKSHEETS

Mari mencocokan

buatlah garis yang cocok dengan namanya!

Persegi

Segitiga

persegi panjang

Lingkaran

LIVEWORKSHEETS