Matemática –Actividad de Refuerzo

Observe las siguientes imágenes y escriba la multiplicación correspondiente, como lo realizamos en clase.

__X__=__

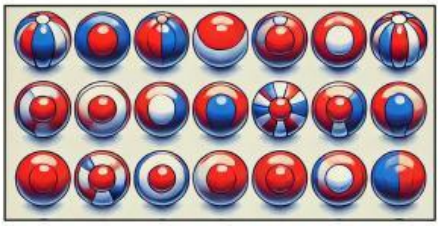

__X__=__

__X__=__



__X__=__

__X__=__

__X__=__

__X__=__

__X__=__



__X__=__

__X__=__



__X__=__

LIVEWORKSHEETS