Lembar Kerja Peserta Didik

LKPD

MATEMATIKA

Operasi Hitung Penjumlahan dan Pengurangan

Nama : _____

Kelas : _____

LIVEWORKSHEETS

Nama: Kelas:

Puzzle Hewan Laut

Hitunglah hasil penjumlahan pada soal di bawah ini. Potonglah puzzle lalu tempelah pecahan puzzle sesuai hasil penjumlahan.

3 + 3 =	5 + 6 =	5 + 0 =
10 + 4 =	8 + 2 =	4 + 3 =
8 + 7 =	5 + 3 =	7 + 5 =

12

8

15

6

14

11

10

5

7

LIVEWORKSHEETS

Pengurangan

.Hitunglah pengurangan perlengkapan sekolah di bawah ini.

Nama :

Kelas :



– = ...

– = ...

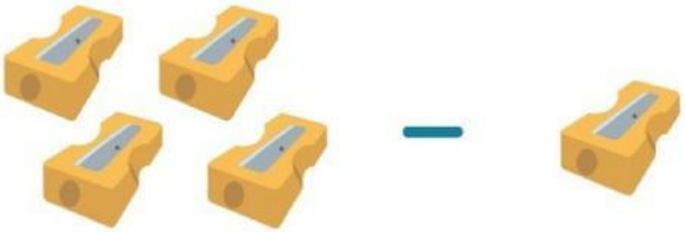

– = ...



– = ...

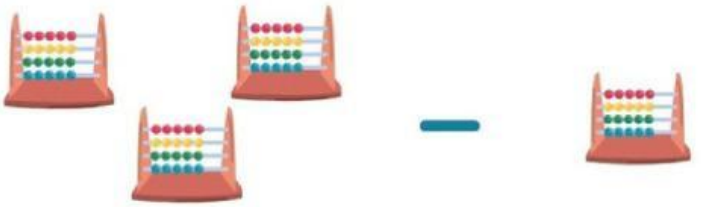

– = ...

LIVEWORKSHEETS