Nama :

Kelas :

SOAL MATEMATIKA KELAS 4 (PECAHAN & POLA GAMBAR)

Pasangkan gambar pecahan di bawah ini dengan nilai pecahannya!

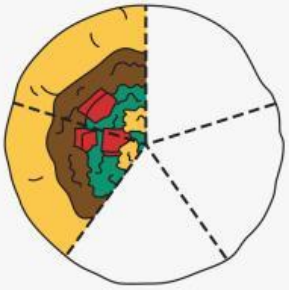

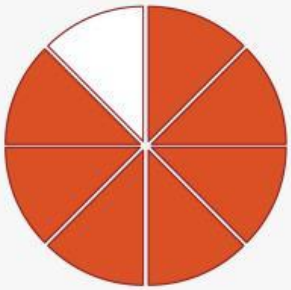

$\frac{4}{6}$

$\frac{7}{8}$

$\frac{3}{6}$

$\frac{2}{5}$

LIVEWORKSHEETS

Perhatikan gambar di bawah ini!

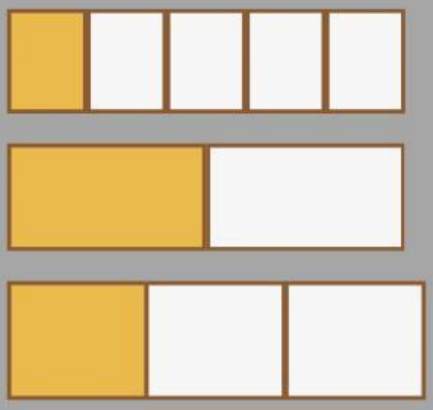

Urutkanlah dari yang:
a) Terkecil ke terbesar
b) Terbesar ke terkecil

Jawaban:

Cobalah bandingkan dua pecahan di bawah ini:

$$\frac{6}{12} \qquad \frac{9}{12}$$

LIVEWORKSHEETS

Ubahlah pecahan 3/4 menjadi bentuk persentase!

Jawaban:

Ubahlah pecahan berikut menjadi bentuk desimal!

$$\frac{7}{10}$$

$$\frac{27}{100}$$

LIVEWORKSHEETS

Lengkapi lah gambar di bawah ini!





Lengakapilah gambar di bawah ini!





LIVEWORKSHEETS