Ejercicio 3

Alumno: _____ Fecha: _____

Calcula el valor de cada ángulo en cada inciso.

a)

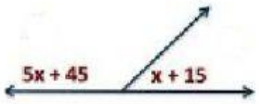

b)

c)

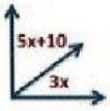

d)

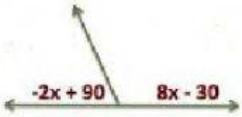

LIVEWORKSHEETS