Fractions

Escribe la fracción de acuerdo con el gráfico.

			

LIVEWORKSHEETS

Fractions

Selecciona la respuesta correcta.

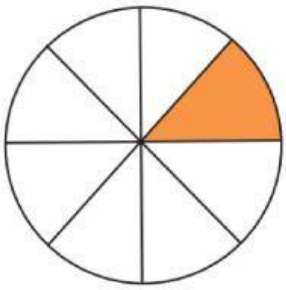

$\frac{2}{5}$ $\frac{1}{7}$ $\frac{1}{8}$

$\frac{3}{6}$ $\frac{4}{7}$ $\frac{1}{4}$

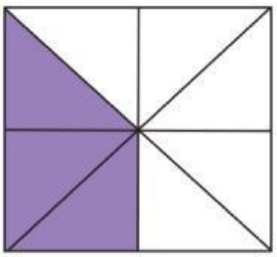

$\frac{1}{6}$ $\frac{2}{3}$ $\frac{3}{8}$

Adriana Guerra Ramirez

LIVEWORKSHEETS