2. Find the unknown angles in the following figures.

(a)

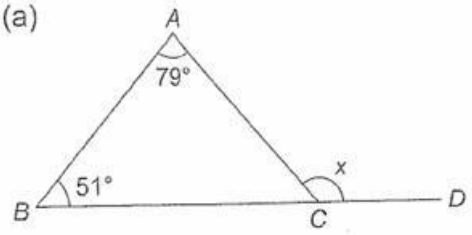

$\angle x =$ _____°

(b)

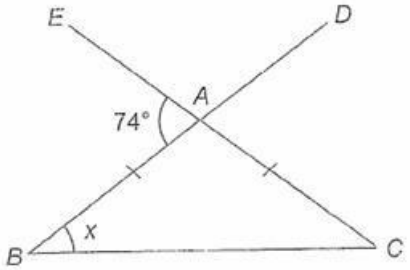

$\angle x =$ _____°

(c)

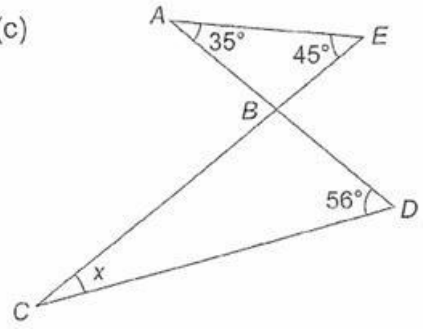

$\angle x =$ _____°

(d)

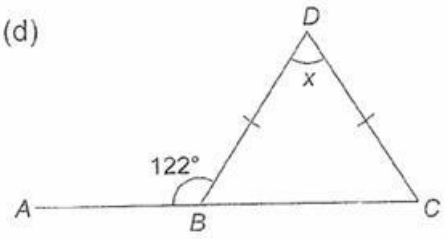

$\angle x =$ _____°

LIVEWORKSHEETS