(1) Angles and Parallel Lines

1. Calculate the value of $x°$ in each of the following figures.

(a)

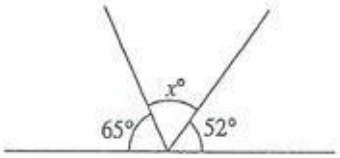

(b)

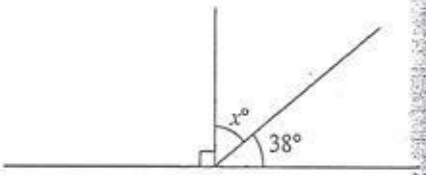

(c)

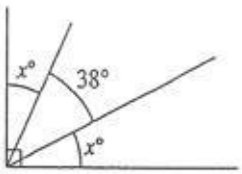

(d)

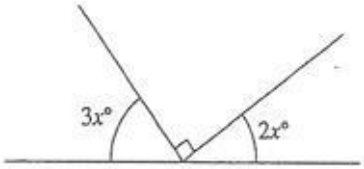

(e)

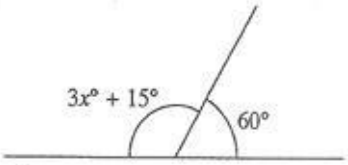

(f)

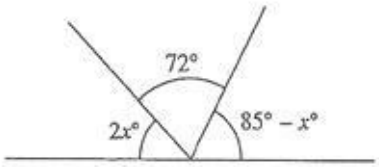

LIVEWORKSHEETS