Identifica o sólido que corresponde a cada uma das seguintes planificações.

(A)

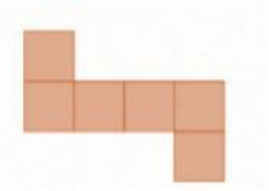

(B)

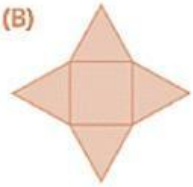

(C)

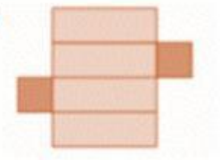

(D)

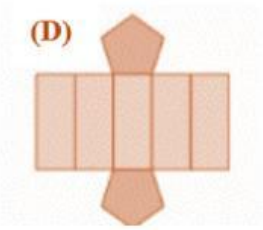

Prisma pentagonal **Cubo** **Prisma quadrangular** **Pirâmide quadrangular**

LIVEWORKSHEETS