Nama :

Hari, Tanggal :

SLB NEGERI Jakarta 5

Tentukanlah panjang benda-benda berikut sesuai hasil pengukuran dengan menempatkan hasil pengukurannya!

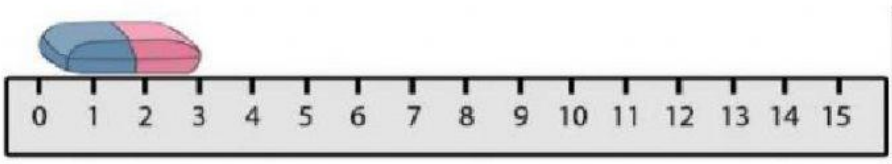

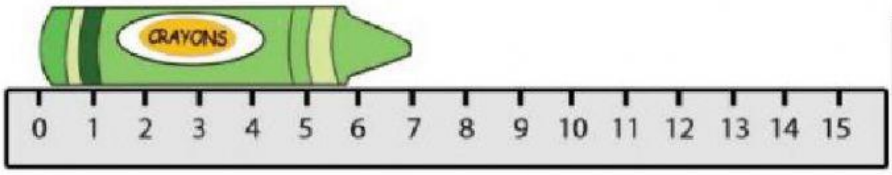

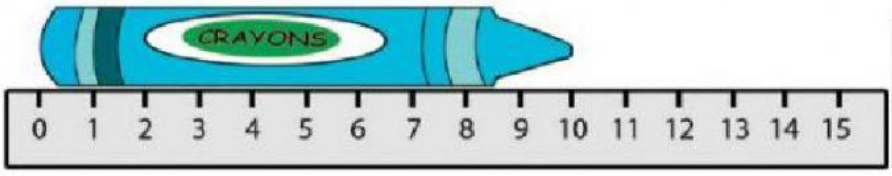

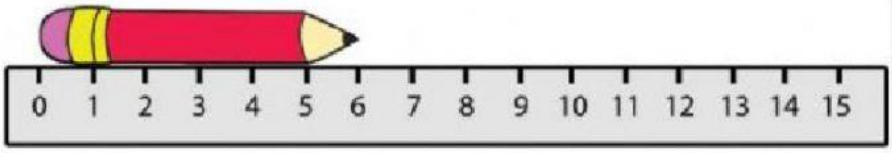

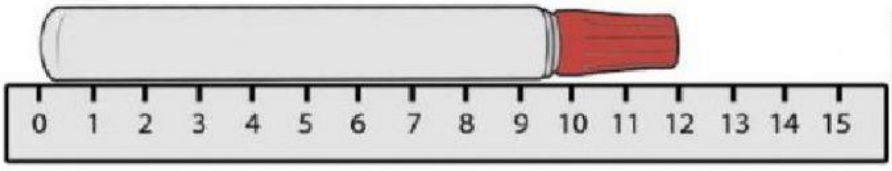

10 cm	12 cm	3 cm	6 cm	7 cm

Ubahlah satuan panjang berikut ini!

1) 200 cm	=		400 m
2) 5 m	=		1 km
3) 1000 m	=		2 m
4) 30 m	=		500 cm
5) 4000 cm	=		3000 cm

LIVEWORKSHEETS