ምዕራፍ ሁለት

2.1 የክፍልፋይ ዓይነቶች

የሚከተሉትን ጥያቄዎች እውነት ወይም ሀሰት በማለት መልሱ

1. ህገኛ ክፍልፋይ ሁልጊዜ ከአንድ ያነሰ ቁጥር ነው
2. የህገኛ ክፍልፋይን ላዕል እና ታዕት አካፍለን የምናመጣው ውጤት ድብልቅ ክፍልፋይ ሊሆን ይችላል
3. የህገወጥ ክፍልፋይን ላዕል እና ታዕት አካፍለን የምናመጣው ውጤት ሙሉ ቁጥር እና ቀሪ ይኖረዋል
4. ድብልቅ ክፍልፋይ ሁልጊዜ ከአንድ በላይ የሆነ ቁጥር ነው
5. አንድ ክፍልፋይ ላዕሉ ከታዕቱ ካነሰ ህገወጥ ክፍልፋይ ይባላል
6. ድብልቅ ክፍልፋይን ወደ ህገወጥ ክፍልፋይ መቀየር ይቻላል

LIVEWORKSHEETS

7. ማንኛውንም ሙሉ ቁጥር በክፍልፋይ መልክ ማስቀመጥ ይቻላል

8. ማንኛዉም ሙሉ ቁጥር ለዜሮ ሲካፈል ውጤቱ ዘሮ ይሆናል

ከዚህ በታች ለተቀመጡት ምስሎች ትክክለኛ የክፍልፋይ ቁጥሩን በባዶ ቦታው ላይ አስቀምጡ

1)

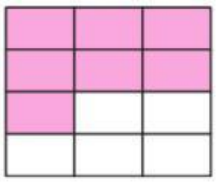

$\frac{\square}{\square}$

2)

$\frac{\square}{\square}$

3)

$\frac{\square}{\square}$

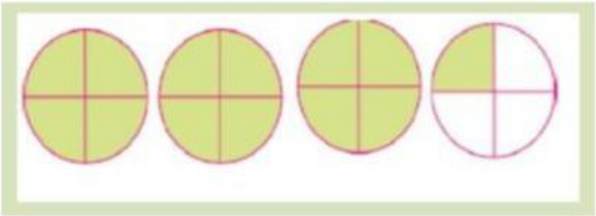

$\square\frac{\square}{\square}$

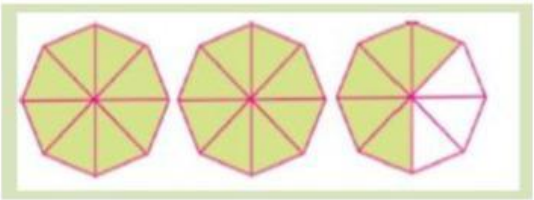

$\square\frac{\square}{\square}$

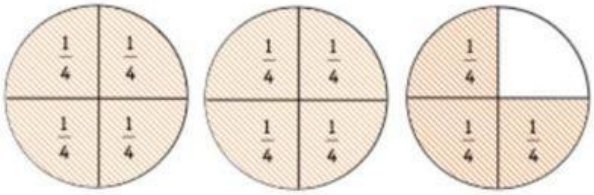

$\square\frac{\square}{\square}$

LIVEWORKSHEETS

ከዚህ በታች ለተቀመጡት ክፍልፋዮች ትክክለኛ የሆነውን የክፍልፋይ ዓይነት ምረጡ

(1)	$1\frac{1}{3}$	_____	(11)	$1\frac{2}{3}$	_____	(21)	$1\frac{1}{6}$	_____
(2)	$\frac{1}{2}$	_____	(12)	$1\frac{2}{5}$	_____	(22)	$\frac{9}{6}$	_____
(3)	$2\frac{2}{3}$	_____	(13)	$\frac{1}{4}$	_____	(23)	$\frac{2}{7}$	_____
(4)	$1\frac{3}{5}$	_____	(14)	$\frac{3}{4}$	_____	(24)	$1\frac{3}{7}$	_____
(5)	$\frac{5}{8}$	_____	(15)	$1\frac{1}{5}$	_____	(25)	$\frac{8}{4}$	_____
(6)	$\frac{2}{3}$	_____	(16)	$\frac{4}{2}$	_____	(26)	$1\frac{1}{9}$	_____
(7)	$\frac{5}{4}$	_____	(17)	$\frac{10}{3}$	_____	(27)	$2\frac{1}{4}$	_____
(8)	$\frac{10}{9}$	_____	(18)	$1\frac{1}{4}$	_____	(28)	$\frac{2}{5}$	_____
(9)	$\frac{3}{2}$	_____	(19)	$\frac{1}{3}$	_____	(29)	$\frac{9}{10}$	_____
(10)	$1\frac{2}{7}$	_____	(20)	$\frac{10}{7}$	_____	(30)	$\frac{5}{9}$	_____

LIVEWORKSHEETS