أَجِدُ مُحيطَ كُلِّ شَكْلٍ مِمّا يَأْتِي:

١٤ سم ١٢ سم ٧ سم ١٣ سم

٧

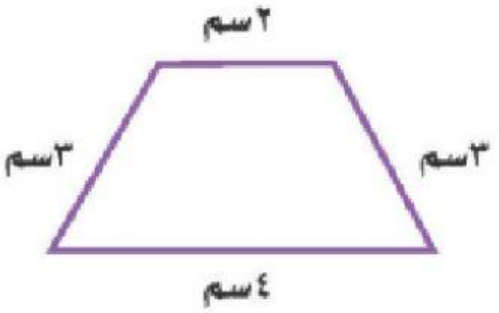

المحيط = سم

٨

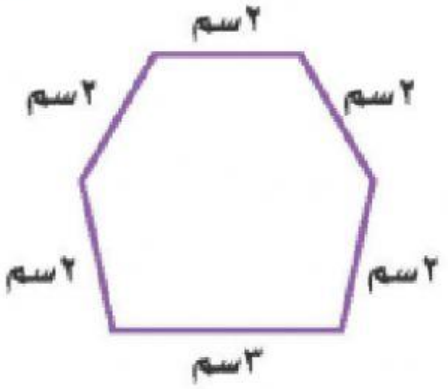

المحيط = سم

٩

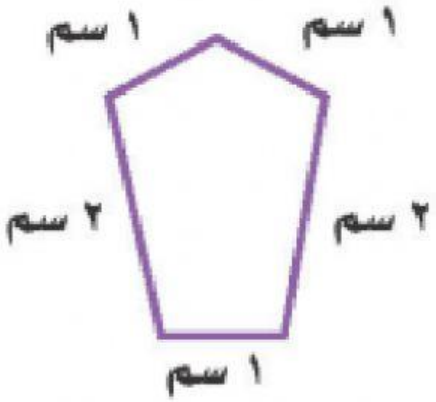

المحيط = سم

LIVEWORKSHEETS