LAS HORAS

1. ¿Qué hora marcan estos relojes?





2. ¿Qué reloj marca estas horas? Relaciona.

Las nueve menos diez Las siete y media Las 6 y veinticinco





3. Completa:

5 h =	min	3 h 45 min =	min
10 min =	s	9 min 17 s =	s

LIVEWORKSHEETS