Codingal
Where kids love coding

Shade the second model exactly the same and determine the equivalent fractions.

1. 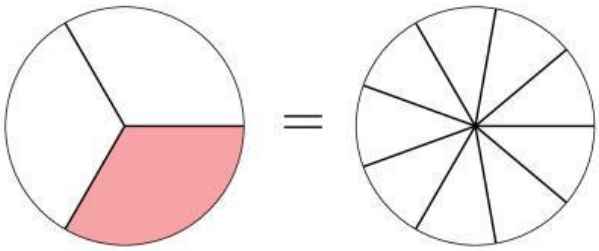 $\frac{\quad}{\quad} = \frac{\quad}{\quad}$

2. 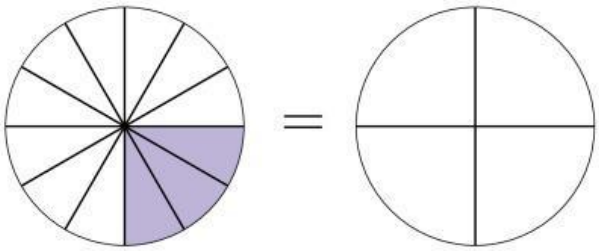 $\frac{\quad}{\quad} = \frac{\quad}{\quad}$

3. 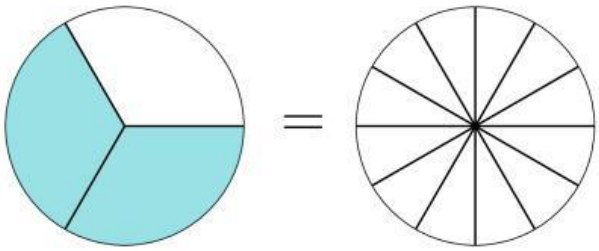 $\frac{\quad}{\quad} = \frac{\quad}{\quad}$

4. 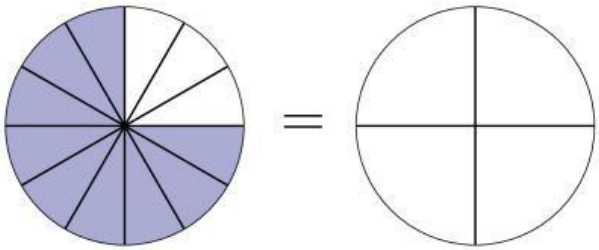 $\frac{\quad}{\quad} = \frac{\quad}{\quad}$

5. 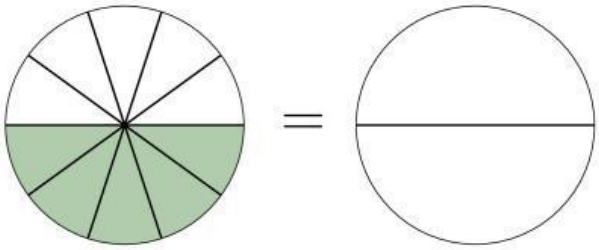 $\frac{\quad}{\quad} = \frac{\quad}{\quad}$

LIVEWORKSHEETS