Nombre: _____ Fecha: _____

Unidad 2: TENEMOS TIEMPO
(Sumas de 2 números con llevadas)

1. Realiza las siguientes operaciones y descubre el nombre de los dinosaurios:

158 + 37 = ____ Pterosaurus	115 + 75 = ____ Dimetrodon	164 + 9 = ____ Pterodactyl	107 + 44 = ____ Ceratosaurus
121 + 39 = ____ Baryonyx	146 + 16 = ____ Styracosaurus	117 + 65 = ____ Triceratops	144 + 48 = ____ Mosasaurus
192 	 160	195 	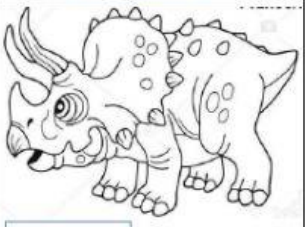 182
Nombre:	Nombre:	Nombre:	Nombre:
162	173	151 	190 
Nombre:	Nombre:	Nombre:	Nombre: