LITTLE KINGS BILINGUAL SCHOOL

Midterm Math

2nd grade

I Bimester

Name:_____

- **Write the number that is represented with the blocks. Then choouse the correct value for each one. 1%**

1.

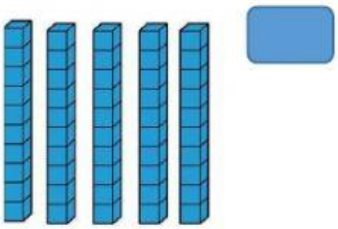

ones | tens

2.

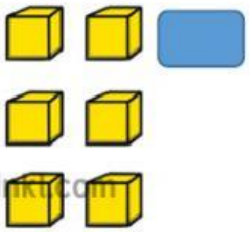

hundred | ones

3.



hundred | tens

4.

ones | tens

LIVEWORKSHEETS

- **Drag the correct number in words. 1%**

1. 300

2. 500

3. 700

Three hundred	Nine hundred
Five hundred	Seven hundred

- **Draw a line to the matching shape. 0.5%**

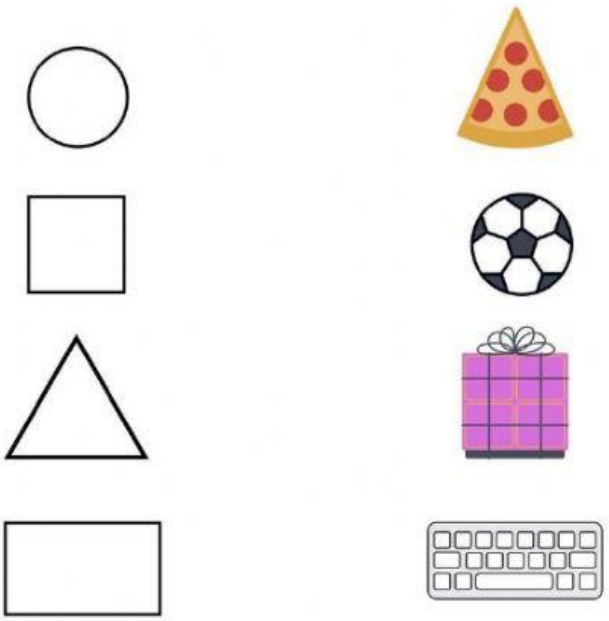

LIVEWORKSHEETS