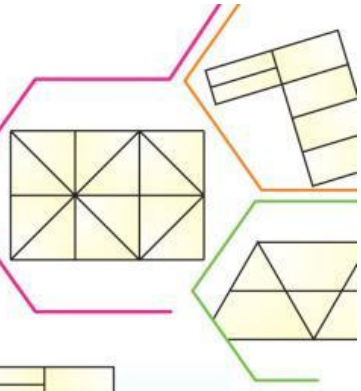

Chapter 40

How Many ?

1. How many rectangles lines does the figure have ?

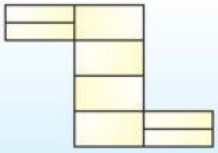

(a) 9 ☐ (b) 10 ☐
(c) 15 ☐ (d) 18 ☐

2. How many squares does the figure have ?

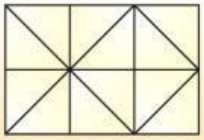

(a) 6 ☐ (b) 9 ☐
(c) 7 ☐ (d) 10 ☐

3. How many triangles are there in the given figure ?



(a) 10 ☐ (b) 9 ☐
(c) 8 ☐ (d) 4 ☐

4. How many triangles are there in the given figure ?

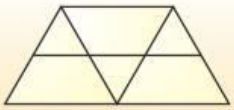

(a) 3 ☐ (b) 5 ☐
(c) 6 ☐ (d) 9 ☐

5. How many squares are there in the given figure ?

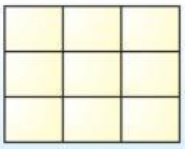

(a) 14 ☐ (b) 12 ☐
(c) 13 ☐ (d) 15 ☐

6. How many triangles are there in the given figure ?

(a) 4 ☐ (b) 6 ☐
(c) 5 ☐ (d) 7 ☐

7. How many triangles are there in the given figure ?

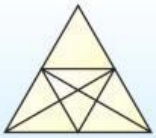

(a) 20 ☐ (b) 21 ☐
(c) 22 ☐ (d) 23 ☐

8. How many triangles are there in the given figure :

(a) 5 ☐ (b) 6 ☐
(c) 8 ☐ (d) 10 ☐

LIVEWORKSHEETS