แบบฝึกหัดท้ายบท
เรื่อง อัตราจังหวะ

คำชี้แจง: ให้นักเรียนรวมจำนวนแล้วตอบคำถาม

1. 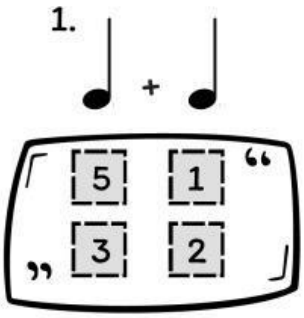

2. 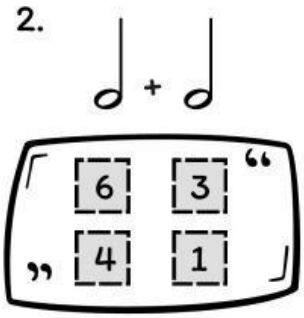

3. 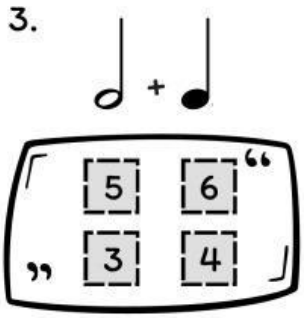

4. 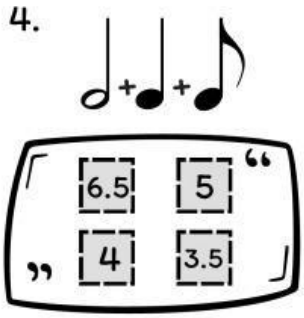

5. 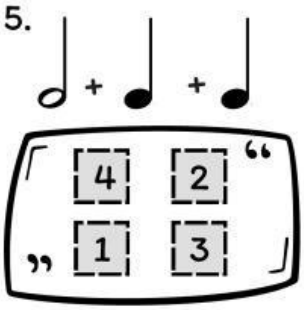

6. 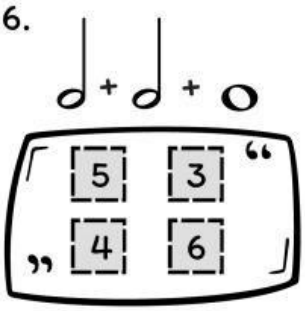

7. 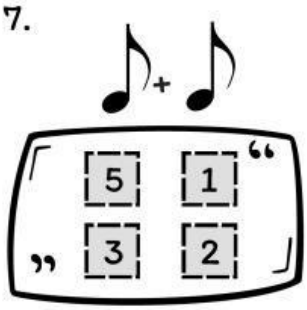

8. 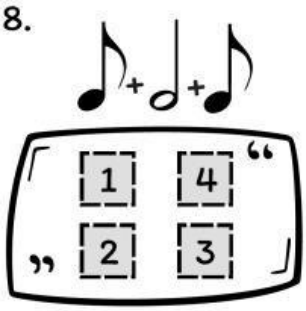

9. 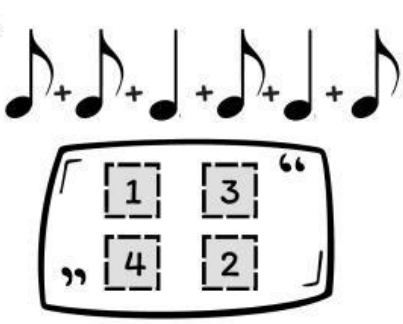

10. 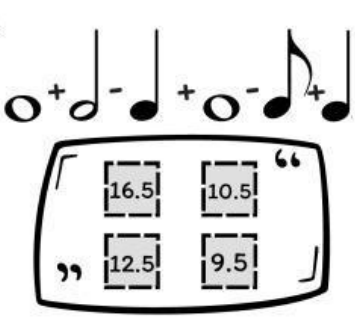

ชื่อ:_____นามสกุล_____ชั้น_____

LIVEWORKSHEETS