Mathematics

Exercise 2 Tens =T Ones =O

Write the place value of the underlined digit in each number.

TO

4<u>5</u>= ones

1. TO

   <u>7</u>8 =

2. TO

   1<u>0</u> =

3. TO

   2<u>9</u> =

LIVEWORKSHEETS

4. TO

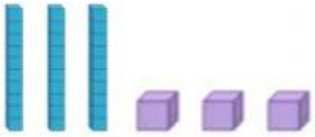

33=

5 TO

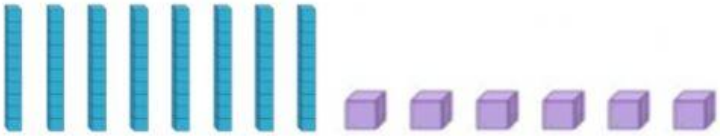

86 =

6 TO

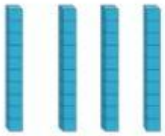

40=

7.TO

59 =

LIVEWORKSHEETS