Grade 3 chapter 1:

Demisemiquaver

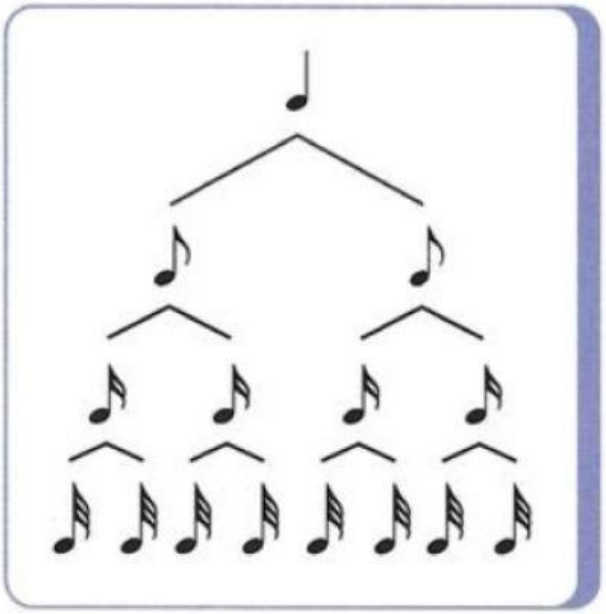

Exercise 1 Add a number in each box to complete these sentences.

a A semiquaver is equal to _____ demisemiquavers.

b A minim is equal to _____ demisemiquavers.

c A dotted crotchet is equal to _____ demisemiquavers.

d Two quavers are equal to _____ demisemiquavers.

e Three semiquavers are equal to _____ demisemiquavers.

LIVEWORKSHEETS

Exercise 2 Number the beats and then circle the correct time signature for each melody.

a



$\frac{2}{4}$ $\frac{3}{4}$ $\frac{3}{8}$

Beats: 1 2 1 2

b



$\frac{3}{4}$ $\frac{3}{8}$ C

Beats:

c

$\frac{2}{2}$ $\frac{3}{2}$ $\frac{3}{4}$

Beats:

d

$\frac{2}{4}$ $\frac{3}{4}$ $\frac{3}{8}$

Beats:

e



$\frac{2}{4}$ $\frac{3}{4}$ $\frac{4}{4}$

Beats:

LIVEWORKSHEETS