Equivalent Fractions Worksheet

Write the missing fraction number above the line.

Multiply or Divide by the **same number** at the bottom & the top

Examples : $\frac{1}{2} \frac{\times 4}{\times 4} = \frac{4}{8}$	Examples : $\frac{4}{10} \frac{\div 2}{\div 2} = \frac{2}{5}$ 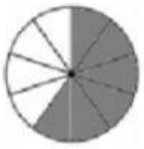
$\frac{1}{3} \frac{\times}{\times} = \frac{}{9}$	$\frac{2}{3} \frac{\times}{\times} = \frac{}{6}$
$\frac{8}{12} \frac{:}{:} = \frac{}{3}$ 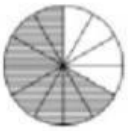	$\frac{4}{4} \frac{:}{:} = \frac{}{2}$ 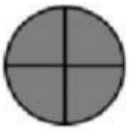
$\frac{3}{5} \frac{\times}{\times} = \frac{}{10}$	$\frac{6}{12} \frac{:}{:} = \frac{}{2}$
$\frac{}{8} \frac{:}{:} = \frac{2}{4}$	$\frac{5}{10} \frac{:}{:} = \frac{}{2}$

LIVEWORKSHEETS