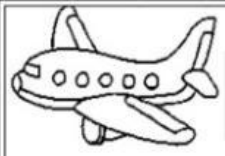

الأعداد ضمن 3 منازل

اكتب العدد المناسب حسب ما تسمع من المعلم في الصناديق :

022	220	202
654	564	456
807	870	708
291	129	921

1 _____

2 _____

3 _____

4 _____

اكتب العدد المناسب الذي يمثله المعداد ثمّ اقرأ العدد

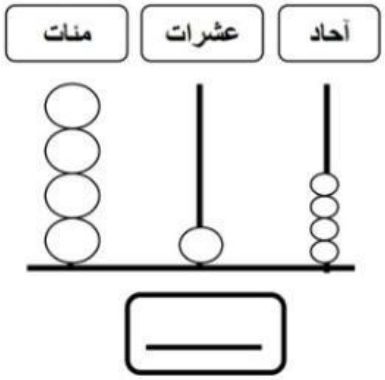

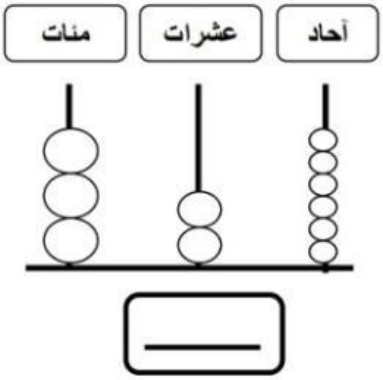

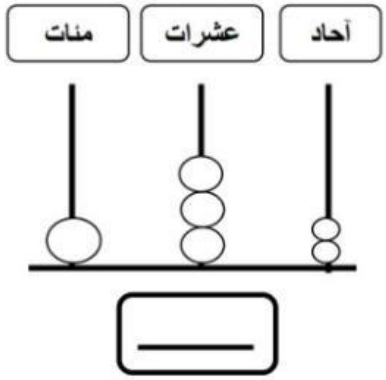

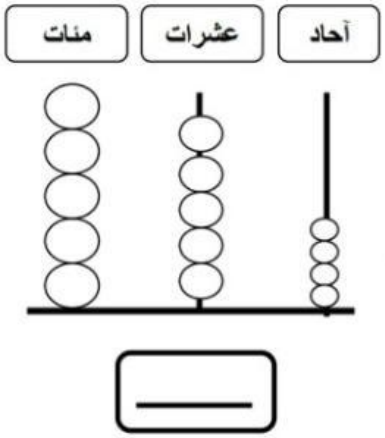

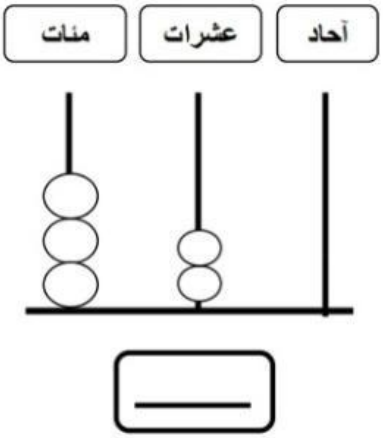

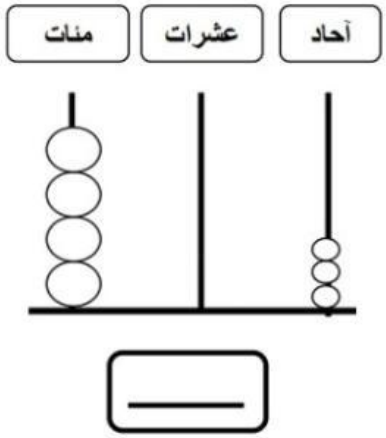

LIVEWORKSHEETS