Exercise 4 Write the missing numbers to identify these intervals above the tonic.

C major

a 

4th

G major

b 

F major

c 

D major

d 

Exercise 5 Tick (✔) **one** box to show the correct number of each interval.

F major

a 

4th	3rd	5th	7th
☐	☐	☐	☐

C major

b

3rd	6th	8ve	2nd
☐	☐	☐	☐

G major

c 

6th	4th	2nd	7th
☐	☐	☐	☐

D major

d 

6th	5th	3rd	4th
☐	☐	☐	☐

LIVEWORKSHEETS