Kindergarten Math Practice

Addition

:

6 + 3 =

8 + 1 =

2 + 6 =

4 + 5 =

3 + 2 =

1 + 1 =

9 + 2 =

5 + 4 =

7 + 3 =

0 + 9 =

Count the following

Count the Number of Apples Below:

uestion: How many apples are there?

Answer:

Count the Number of Ananas Below:

uestion: How many Ananas are there?

Answer:

Count the Number of Oranges Below:

uestion: How many Oranges are there?

Answer:

Simple Word Problems

ve 4 oranges and you buy 3
y oranges do you have now

are 6 cars in the parking lo
eave, how many cars are s
rking lot?

e 8 ducks at the pond.
s swim away, how many
e left?

ve 7 pencils and you find 2
y pencils do you have altog

are 10 cookies in a jar.
4 cookies, how many
re left in the jar?

✔ Addition ✔ Subtraction ✔ Counting ✔ and More!

LIVEWORKSHEETS

Addition

Solve the following :

2 + 3 =	6 + 3 =
1 + 5 =	8 + 1 =
4 + 4 =	2 + 6 =
7 + 2 =	4 + 5 =
6 + 1 =	3 + 2 =
0 + 8 =	1 + 1 =
3 + 3 =	9 + 2 =
5 + 2 =	5 + 4 =
9 + 0 =	7 + 3 =
7 + 1 =	0 + 9 =

LIVEWORKSHEETS

subtraction

Solve the following :

9 - 4 =	8 - 6 =
8 - 3 =	7 - 5 =
7 - 2 =	6 - 2 =
6 - 5 =	5 - 4 =
5 - 1 =	4 - 3 =
4 - 0 =	3 - 2 =
3 - 3 =	2 - 0 =
2 - 1 =	1 - 1 =
1 - 0 =	0 - 0 =
9 - 7 =	9 - 9 =

LIVEWORKSHEETS

Simple Word Problems

1- You have 4 oranges and you buy 3 more. How many oranges do you have now?

2- There are 6 cars in the parking lot. If 3 cars leave, how many cars are still in the parking lot?

3- You see 8 ducks at the pond. If 5 ducks swim away, how many ducks are left?

4- You have 7 pencils and you find 2 more. How many pencils do you have altogether?

5- There are 10 cookies in a jar. If you eat 4 cookies, how many cookies are left in the jar?

LIVEWORKSHEETS

Count the following

1 -Count the Number of Apples Below:

Question: How many apples are there?

Answer:

2 -Count the Number of Ananas Below:



Question: How many Ananas are there?

Answer:

2 -Count the Number of Oranges Below:



Question: How many Oranges are there?

Answer:

LIVEWORKSHEETS

Count the following

4 -Count the Number of Stars Below:

Question: How many Stars are there?

Answer:

5 -Count the Number of Tomatoes Below:

Question: How many Tomatoes are there?

Answer:

6 -Count the Number of Batatas Below:

Question: How many Batatas are there?

Answer:

LIVEWORKSHEETS

Number Patterns

Question: What comes next?



LIVEWORKSHEETS

Comparing Numbers

Color the apple with the larger number ?



LIVEWORKSHEETS

Comparing Numbers

Color the apple with the larger number ?



LIVEWORKSHEETS