Grade 1 Mathematics

Worksheet#06

Time and 2D shapes

Q.1 Fill in the blanks.

(i) _____ has opposite sides equal in length.

(ii) Half day = _____ Hours.

(iii) There are _____ minutes in an hour.

Q.2 Drag and drop the shape and complete the table.

Shape	Name of Shape	Number of sides	Number of corners
		4	
			0
	Hexagon		



Q.3 Look at the pattern and select the shape that will come next.

a)

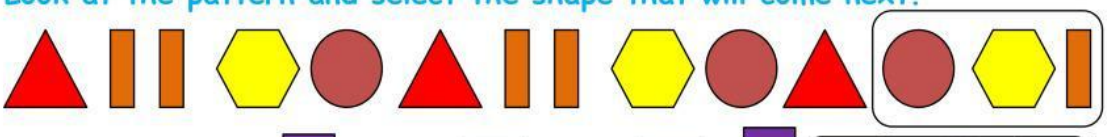

b)

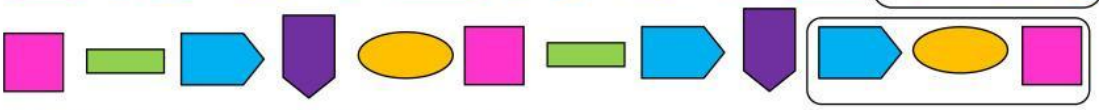

Q.4 Match the clocks with the correct time.

7 O'clock

Half past 9

9 : 30

6 O'clock

8:30

07:00

11:00

Half past 2

LIVEWORKSHEETS