LEMBAR KERJA PESERTA DIDIK

MATEMATIKA

SMP/MTs Kelas IX



KEKONGRUENAN & KESEBANGUNAN

LIVEWORKSHEETS

MATERI 1

MATERI 2

MATERI 3

MATERI 4

LIVEWORKSHEETS

Latihan Soal

1 Bangun mana yang kongruen dengan jajar genjang di samping?

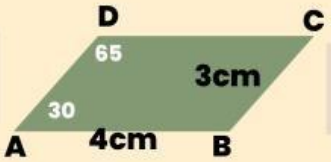

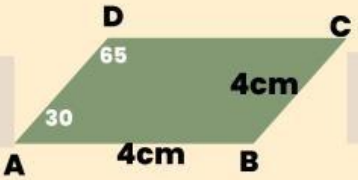

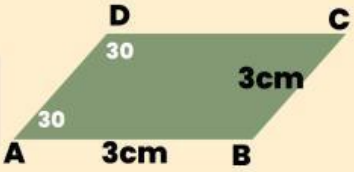

2 Tentukan ukuran RS!

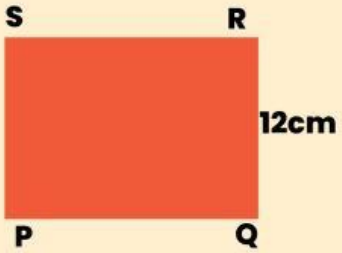

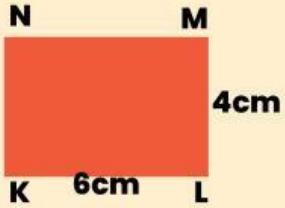

Jawab:

LIVEWORKSHEETS

Latihan Soal

3 Tentukan ukuran PQ!

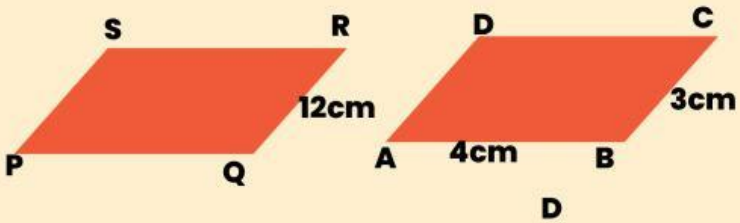

- 16 cm
- 14 cm
- 24 cm

4 Carilah segi empat yang sebangun dengan persegi KLMN!

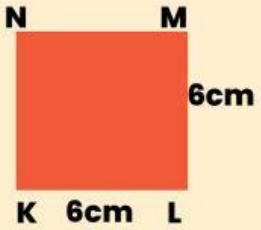

LIVEWORKSHEETS

Latihan Soal

5 Tentukan ukuran AB!

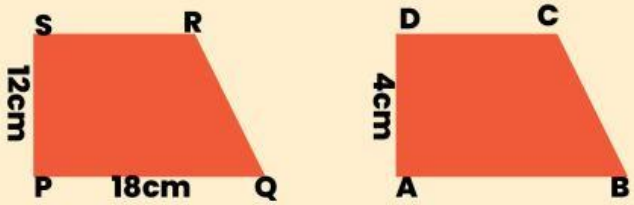

- 8cm
- 6cm
- 12cm

LIVEWORKSHEETS