Nama: Kelas:

Bangun Ruangku

Lingkarilah pada nama yang tepat untuk gambar di samping.

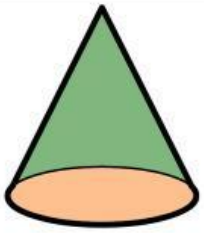

Kubus Balok Tabung

Prisma Segitiga Kerucut



Kubus Balok Tabung

Prisma Segitiga Kerucut

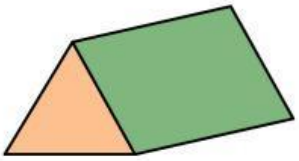

Kubus Balok Tabung

Prisma Segitiga Kerucut

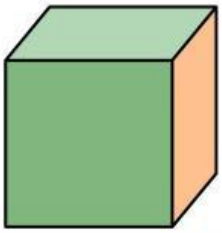

Kubus Balok Tabung

Prisma Segitiga Kerucut

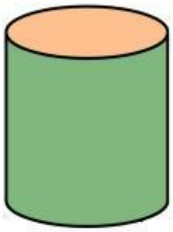

Kubus Balok Tabung

Prisma Segitiga Kerucut

LIVEWORKSHEETS

Perhatikan video di bawah ini, kemudian kerjakan soalnya!



LIVEWORKSHEETS