LEMBAR KERJA PESERTA DIDIK

LKPD

ARDIANA NUR MAULIDA HAKIM

LIVEWORKSHEETS

PERHATIKAN VIDEO DI BAWAH INI!

LIVEWORKSHEETS

Nama :
Kelompok :

Hitunglah Operasi penjumlahan berikut ini dengan hasil yang tepat!

☐ + ☐ = ☐

☐ + ☐ = ☐

☐ + ☐ = ☐

☐ + ☐ = ☐

☐ + ☐ = ☐

LIVEWORKSHEETS

pilihlah penambahan yang sesuai dengan gambarnya

7 + 2

7 + 3

7 + 4

10 + 3

10 + 4

10 + 5

10 + 2

2 + 10

2 + 8

5 + 5

5 + 7

5 + 6

5 + 5

5 + 7

5 + 6

LIVEWORKSHEETS

TARIKLAH GARIS SESUAI DENGAN JUMLAHNYA







LIVEWORKSHEETS