LEMBAR KERJA PESERTA DIDIK

By : Erlin Mbere

LIVEWORKSHEETS

1. Perhatikan angka di bawah ini dan tentukan satuan, puluhan, ratusan dan ribuan

a.

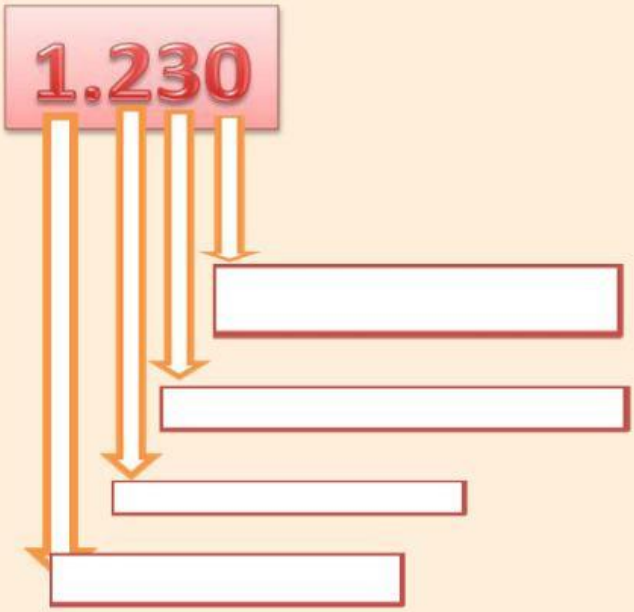

b.

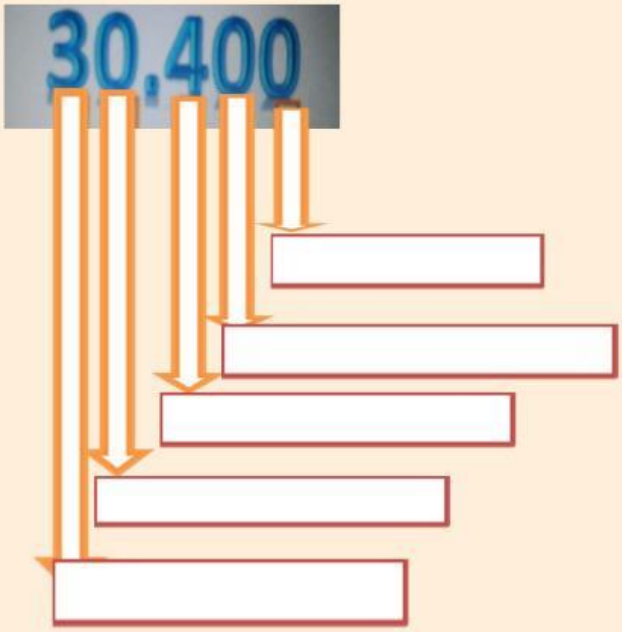

LIVEWORKSHEETS

2. Tulislah bilangan dari soal di bawah ini

a. 4.000

b. 1.340

LIVEWORKSHEETS

3. PERHATIKAN GAMBAR PADA TABEL BERIKUT INI!

ANGKA UANG	BERAPAKAH UANG PADA GAMBAR TERSEBUT
	LIMA RIBU

LIVEWORKSHEETS

4. Perhatikan Gambar Berikut!

A.



B



LIVEWORKSHEETS

Terima kasih

LIVEWORKSHEETS