IQ School Primary 5 - Maths

Unit 5: Ratio

Name: ( )	Class:	Date:

Fill in table with the correct answer after simplifying.

What is the ratio of black counters to white? _____  Simplify your answer _____	What is the ratio of black counters to white? _____  Simplify your answer _____
What is the ratio of white counters to black? _____ Simplify your answer _____	What is the ratio of black counters to white? _____ 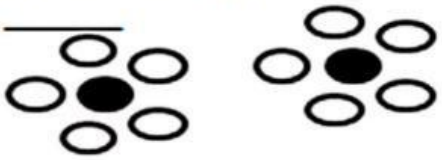 Simplify your answer _____
What is the ratio of black counters to white? _____  Simplify your answer _____	What is the ratio of white counters to black? _____  Simplify your answer _____
What is the ratio of white counters to black? _____ Simplify your answer _____	What is the ratio of black counters to white? _____  Simplify your answer _____

LIVEWORKSHEETS