GREENFIELD SCHOOL
Happy School : an education from the heart within

Cambridge Assessment International Education
Cambridge International School

CAMBRIDGE PRIMARY MATHEMATICS 1

7.2. VENN DIAGRAMS

Name: _____ **Date:** _____ **Class:** _____

Part 1. Look at the Venn diagram and answer these questions.



How many flowers with only 3 leaves? ☐

How many flowers with more than 3 leaves? ☐

Draw a ring around the correct word.

There are **more / fewer** flowers with 3 leaves than flowers with 4 leaves.

LIVEWORKSHEETS

Part 2. Label the circles.

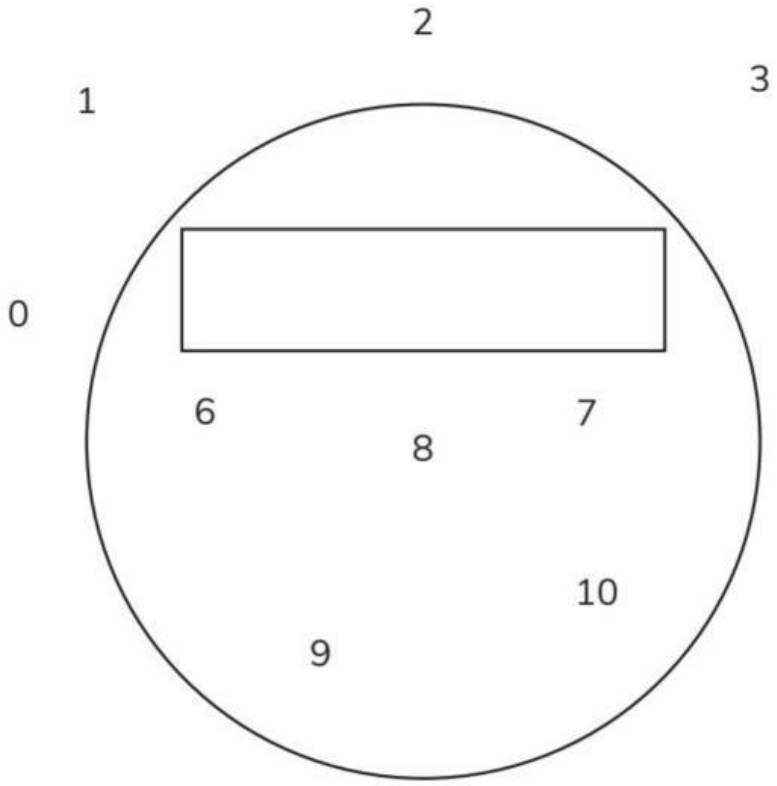



LIVEWORKSHEETS