9 Numbers to 20

› 9.1 Counting to 20

1. Write the missing numbers.

1	2	3	4	5	6	7	8	9	10
11	12	13		15	16		18		20

2. Write the missing numbers.

14	

12		

18		

3. Complete these part-whole diagrams.

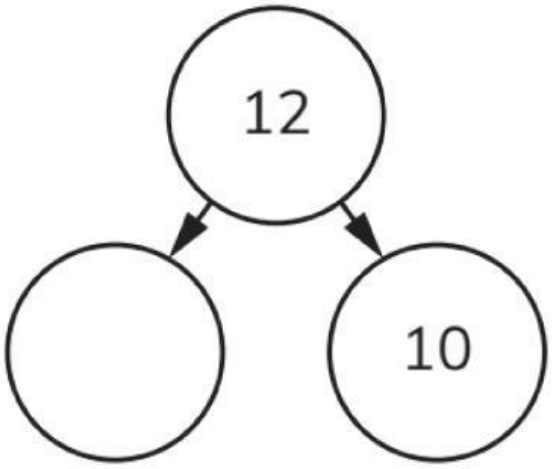

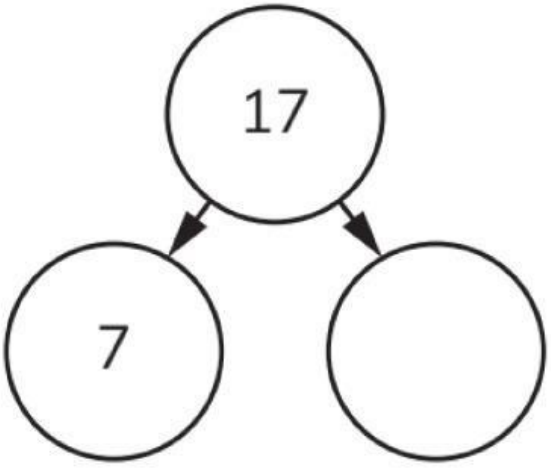

LIVEWORKSHEETS

4. Write these numbers in words. Use these words to help you.

six seven eight

16	
17	
18	

5. Write the missing numbers.

	16	

	12	

	14

6. Complete these part-whole diagrams.

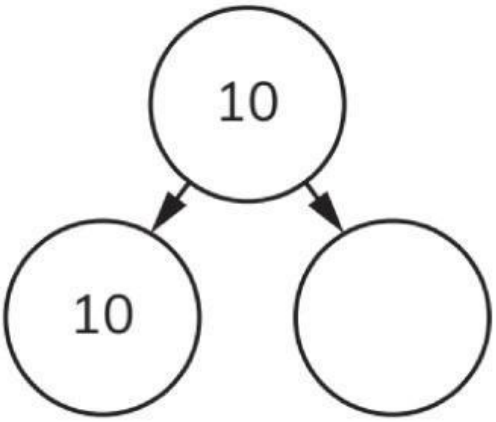

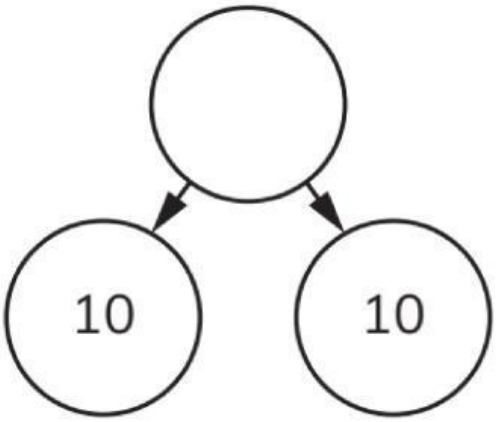

LIVEWORKSHEETS

7. Write these numbers in words.

12	
14	
19	

7. Write the missing numbers.

14 = ☐ tens and ☐ ones

17 = ☐ tens and ☐ ones

1 ten and 6 ones = ☐

2 tens and 0 ones = ☐

LIVEWORKSHEETS