Name _____ **Date** _____

Unit 6 test: Measurement, area and perimeter

1 Identify, name and describe these 2D shapes.

a 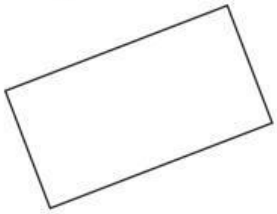 Name: _____

b  Name: _____

c  Name: _____

2 Classify these 2D shapes.

a semicircle	☐ vertices ☐ straight sides ☐ curved sides	d rectangle	☐ vertices ☐ straight sides ☐ curved sides
b octagon	☐ vertices ☐ straight sides ☐ curved sides	e circle	☐ vertices ☐ straight sides ☐ curved side
c hexagon	☐ vertices ☐ straight sides ☐ curved sides		

LIVEWORKSHEETS

3 Calculate the perimeters of these shapes.

a

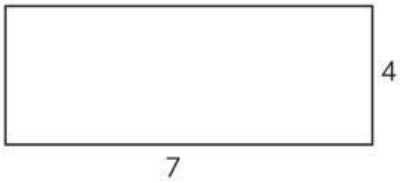

perimeter: _____

b

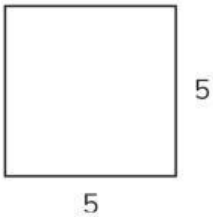

perimeter: _____

c

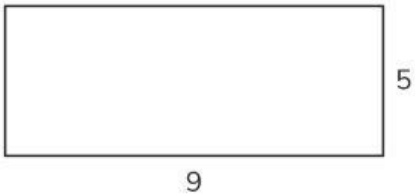

perimeter: _____

4 Measure and calculate the area of this shape.



length of each side: _____

measured area: _____ square centimetres

5 Calculate the area of these shapes. Each square is 1 square centimetre.

a b

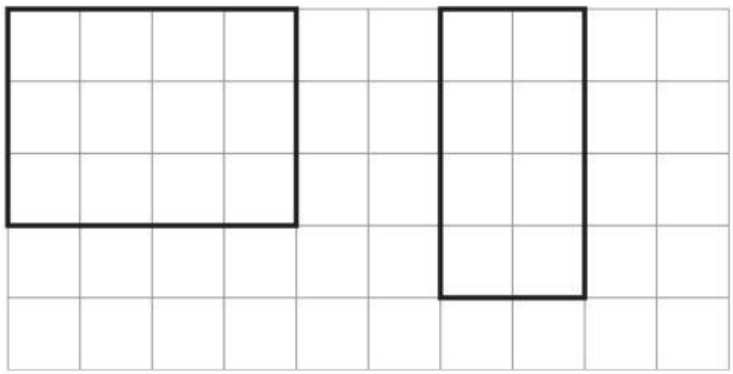

- THE END -

LIVEWORKSHEETS