Nama: _____ Date: _____

Struktur Bumi

Lihat gambar dan pilih satu jawaban yang benar

Atmosfer / Hidrosfer	Litosfer / Atmosfer
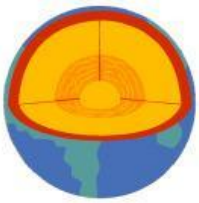 Atmosfer / Litosfer	Litosfer / Hidrosfer
Tanah / Air	Tanah / Air
Kerak / Mantel	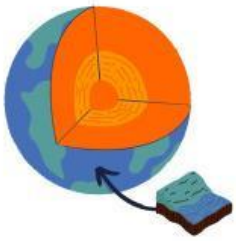 Kerak / Mantel
Inti dalam / Inti luar	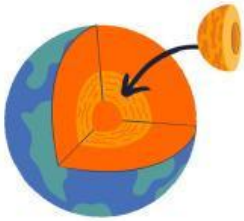 Inti dalam / Inti luar

LIVEWORKSHEETS