INSPIRED TOTS EARLY LEARNING CENTER, JOS
THIRD TERM CONTINOUS ASSESSMENT, 2024

NAME: _____

MATHEMATICS 1ST GRADE

1. The second day of the week is___

a) Monday b) Tuesday c) Wednesday d) Thursday

2. The fifth day of the week is our Bible week. What day is that?

a) Monday b) Tuesday c) Wednesday d) Thursday

3. Every last day of the week we go to the gym. What day is that?

a) Monday b) Tuesday c) Wednesday d) Saturday

4. 4 days after Wednesday is _____

a) Monday b) Sunday c) Wednesday d) Thursday

5. 6 days after Saturday is _____

a) Monday b) Tuesday c) Friday d) Thursday

6. Which is the first month of the year? _____ a) February b) Match

c) January d) August

7. What day of the month is children's day? _____ a) 27th b) 25th

c) 30th d) 29th

8. What month of the year is children's day? _____ a) February b) Match

c) December d) May

9. Write the 3rd month_____5th month _____and 7th month of the year_____

10. How many days are in a week? _____ a) 24 b) 12 c) 7 d) 30

11. There are approximately _____ weeks in a month? a) 4 b) 6

c) 17 d) 7

12. What is the general name given to the shapes in the box below? _____

a) 2D-Shapes b) 3D-Shapes c) 4D-Shapes d) 7D-Shapes

LIVEWORKSHEETS

INSPIRED TOTS EARLY LEARNING CENTER, JOS
THIRD TERM CONTINOUS ASSESSMENT, 2024

NAME: _____

13.

Drag and drop the correct names of the solid shapes and complete their properties.

SQUARE PYRAMID CUBE CONE TRIANGULAR PYRAMID SPHERE CYLINDER CUBOID

Solid	Name	Faces	Edges	Vertices
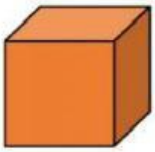				

LIVEWORKSHEETS

INSPIRED TOTS EARLY LEARNING CENTER, JOS
THIRD TERM CONTINOUS ASSESSMENT, 2024

NAME: _____

14. What is the general name given to the shapes in the box below? _____

a) 2D-Shapes b) 3D-Shapes c) 4D-Shapes d) 7D-Shapes

15.

Find the perimeter of the following shapes.

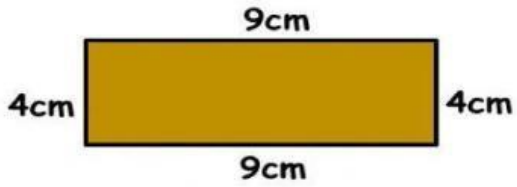

Perimeter =

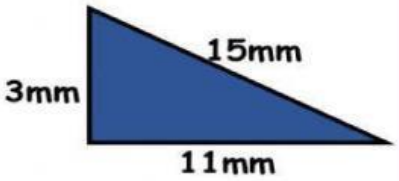

Perimeter =

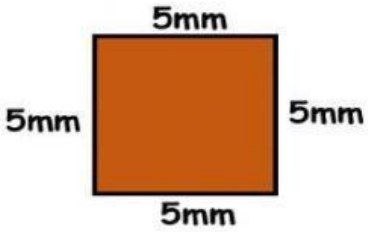

Perimeter =

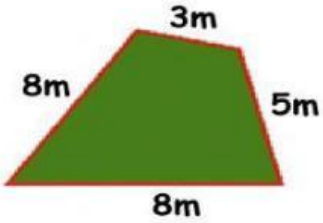

Perimeter =

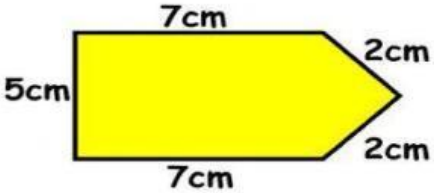

Perimeter =

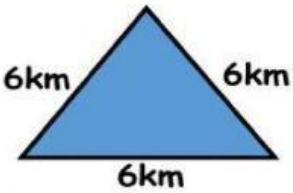

Perimeter =

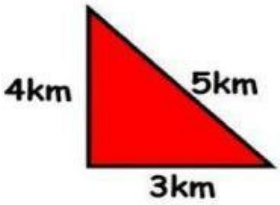

Perimeter =

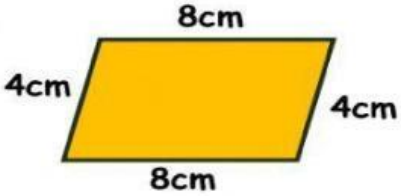

Perimeter =

LIVEWORKSHEETS