MATH QUIZ – 2nd grade

NAME:

1. Solve the following multiplications. (40 pts)

18	40	35	42	21	25	49	36	45	56

- 5 x 5 = _____
- 6 x 3 = _____
- 7 x 7 = _____
- 5 x 8 = _____
- 6 x 6 = _____
- 7 x 5 = _____
- 5 x 9 = _____
- 6 x 7 = _____
- 7 x 8 = _____
- 7 x 3 = _____

2 Identify the multiplication property used in each equation. (20 pts)

a) 7 x 1 = 7
1 x 7 = 7

b) 6 x 8 = 8 x 6
48 = 48

c) (3 x 2) x 4 = 3 x (2 x 4)
6 x 4 = 3 x 8
24 = 24

d) 7 x 0 = 0 x 7 = 0

LIVEWORKSHEETS

3. Find the perimeter of the following shapes. (40 pts)

1.



Perimeter _____

2.

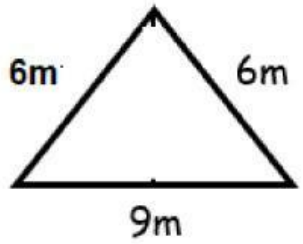

Perimeter _____

3.

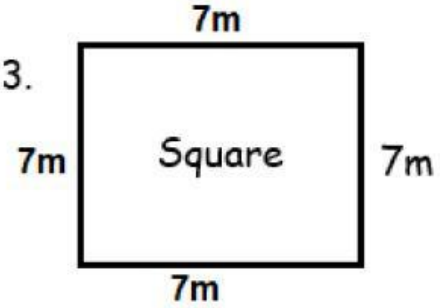

Perimeter _____

4.

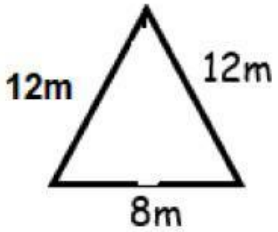

Perimeter _____

5.

Perimeter _____

6.

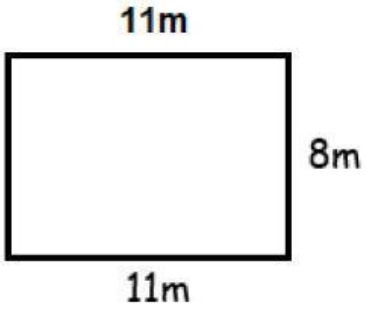

Perimeter _____

You are brilliant

LIVEWORKSHEETS