ÁREAS

1º.- CALCULA EL ÁREA DE LAS SIGUIENTES FIGURAS.

A) CUADRADO Y RECTÁNGULO

	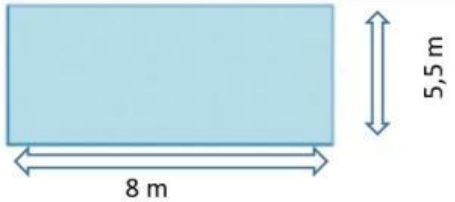
FORMULA: _____ SUSTITUIR: _____ RESULTADO: _____ ^{2}	FORMULA: _____ SUSTITUIR: _____ RESULTADO: _____ ^{2}

C) TRIÁNGULO

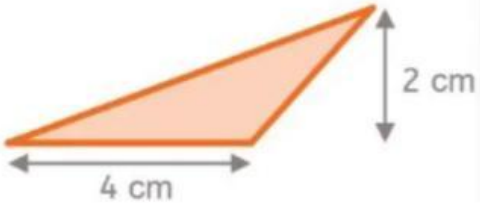	FORMULA: _____ SUSTITUIR: _____ RESULTADO: _____ ^{2}

D) CÍRCULO

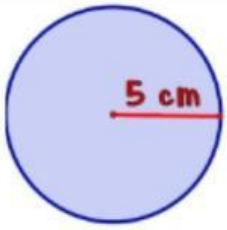	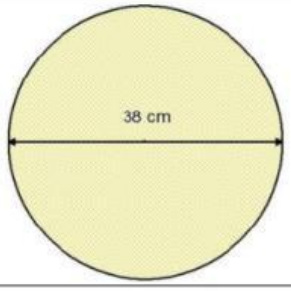
FORMULA: _____ ^{2} ___ SUSTITUIR: _____ ^{2} _ = _____ RESULTADO: _____ ^{2}	FORMULA: _____ ^{2} _ SUSTITUIR: _____ ^{2} _ = _____ RESULTADO: _____ ^{2}

E) FIGURA COMPUESTA

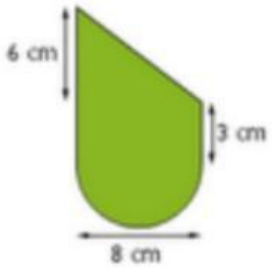	Área figura 1: _____ ^{2} Área figura 2: _____ ^{2} Área figura 3: _____ ^{2} Área total: _____ ^{2}

LIVEWORKSHEETS